APLICO LO APRENDIDO

¡Vamos tú puedes, empieza ahora !

1. Descomponer los siguientes números en factores primos.

50	22
50 = ◯ x ◯ x ◯	22 = ◯ x ◯

2. Descomponer en sus factores primos a través del diagrama del árbol.

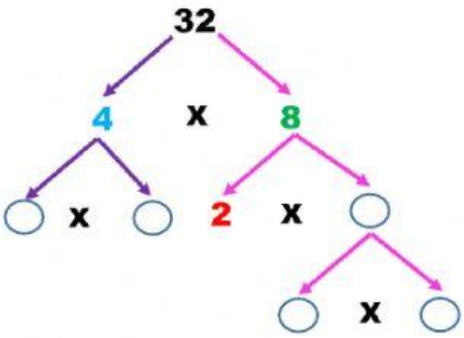

32 = ◯ x ◯ x ◯ x ◯ x ◯

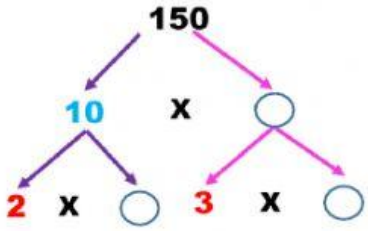

150 = ◯ x ◯ x ◯ x ◯

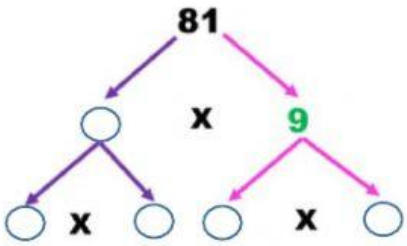

81 = ◯ x ◯ x ◯ x ◯

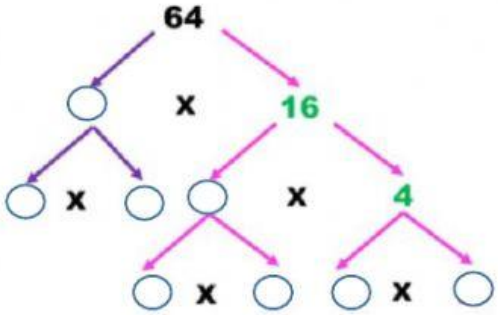

64 = ◯ x ◯ x ◯ x ◯ x ◯ x ◯