Adición

Resuelve las siguientes sumas



$$\begin{array}{r} 3 \\ +\,2 \\ \hline \square \end{array}$$



$$\begin{array}{r} 4 \\ +\,5 \\ \hline \square \end{array}$$



$$\begin{array}{r} 3 \\ +\,3 \\ \hline \square \end{array}$$

$$\begin{array}{r} 3 \\ +\,2 \\ \hline \square \end{array}$$



$$\begin{array}{r} 2 \\ +\,2 \\ \hline \square \end{array}$$

Miss Elisa P.