1) NAME the five main GROUPS of VERTEBRATES:

1)	2)	3)	4)	5)

2) Say if this statements are TRUE or FALSE.

Fish can take oxygen from water

Amphibians´ skin must be wet.

Almost all amphibians are oviparous

Most of reptiles are viviparous.

Vertebrates and invertebrates have a backbone.

3) Drag and Drop the parts of the fish.

SCALES GILLS FINS TAIL



4) NAME the six main GROUPS of INVERTEBRATES:

1) 2) 3) 4) 5) 6)

5) TICK the correct statements about invertebrates.

They have no legs and no hard covering

Snails, octopuses and mussels are an example of Molluscs

Porifera are very complex invertebrates.

Arthropods haven´t a Body covered in armour plates and no legs.

6) Write vertebrate or invertebrate.

They have internal bone and skeleton.

They don´t have internal bone or skeleton.

They can be oviparous or viviparous.

They are only oviparous.

7) Complete the process of nutrition of a plant.

Xylem sap Roots Sunlight Carbon dioxide Oxygen

Photosynthesis Water Leaves Mineral Sales

This process is called _____.

The _____ absorb _____ and _____from the soil.

This mixture is called _____.

Xylem sap travels through the stem to the _____.

The leaves absorb _____**and** _____, which help

the plant to transform that into _____.

8) Join with arrows

Nutrition	is producing offspring
Interaction	consists of obtaining food and water
Reproduction	is the reaction of a living organism to changes in its environment.

9) Complete with the correct words.

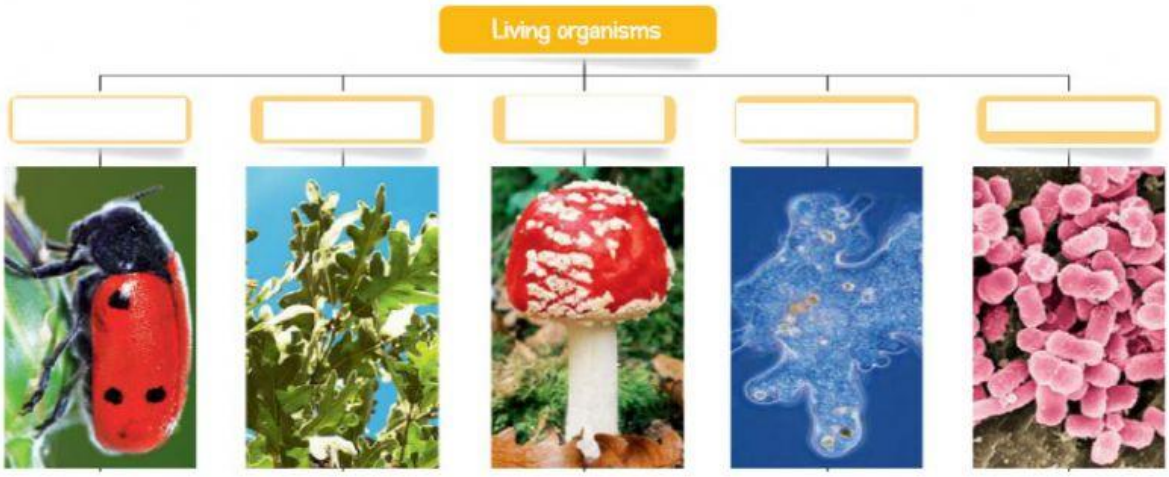

10)Complete with the parts of a flower.

Petal Stigma Anther Stamen Style Filament
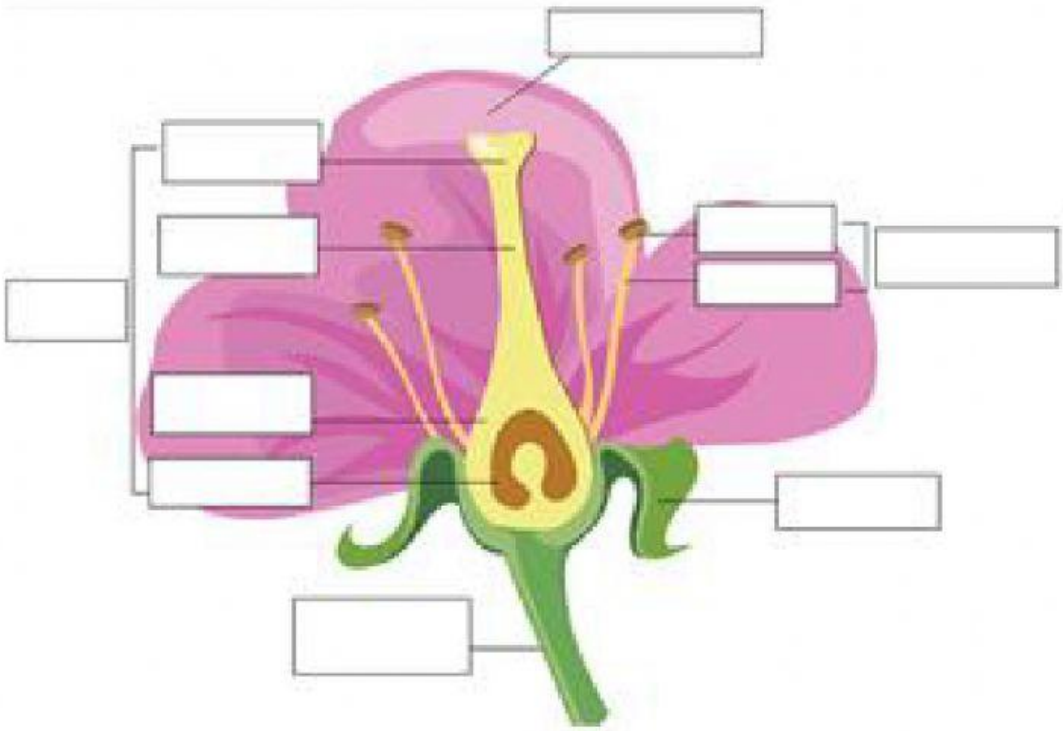
Stem Sepal Ovary Ovule Pistil