Name:_____ Date:_____

Mathematics

Circumference of a Circle

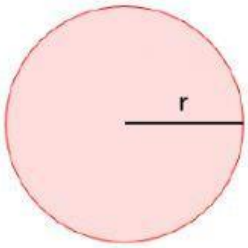

Circumference of circle

$C = 2\pi r$

Use the formula to find the circumference of each circle.

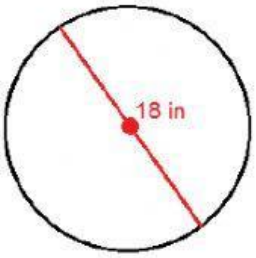

Ans: _____

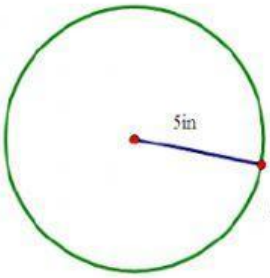

Ans: _____

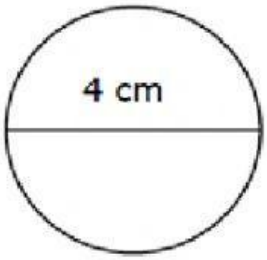

Ans: _____

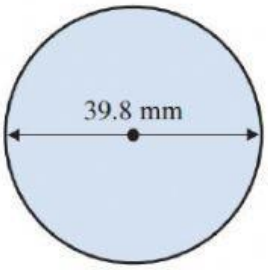

Ans: _____

The radius of circle is 2.5 cm long. How long is the diameter?

Ans:_____

The diameter of circle is 15 cm long. How long is the radius?

Ans:_____

Created by: Ms. A. Bain