2nd Grade
Social Studies Exam
III Quarter

Name: _____

Date: _____

Matching

Draw a line to from the word to the picture

Globe

Map

Continents

Ocean

Equator



Hemisphere

LIVEWORKSHEETS

2nd Grade
Social Studies Exam
III Quarter

Label each continent using the word bank.

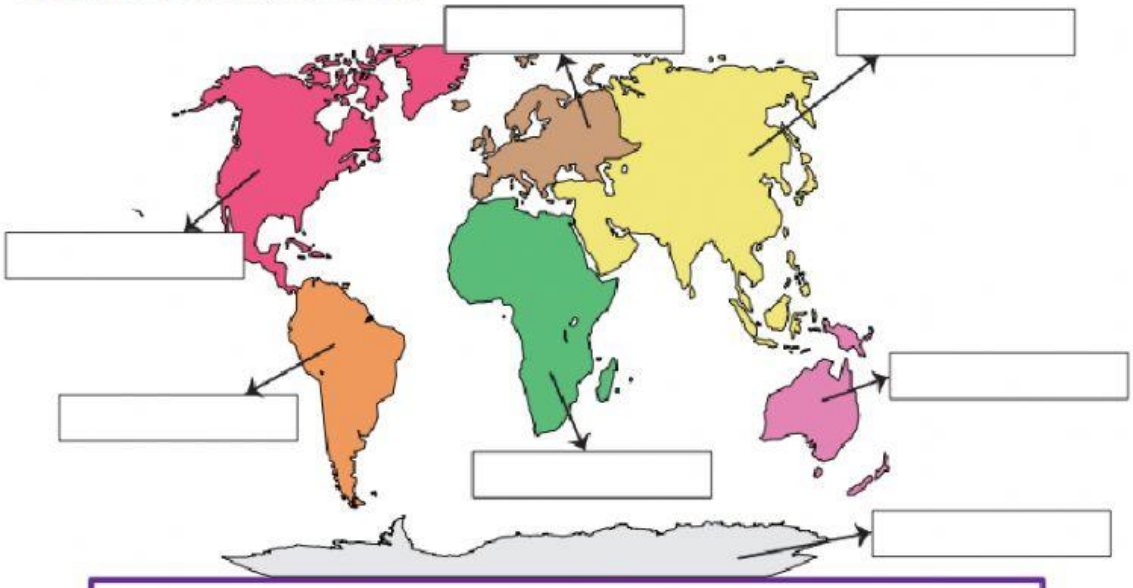

Africa North America South America Australia Antarctica Asia Europe

Label each ocean using the word bank

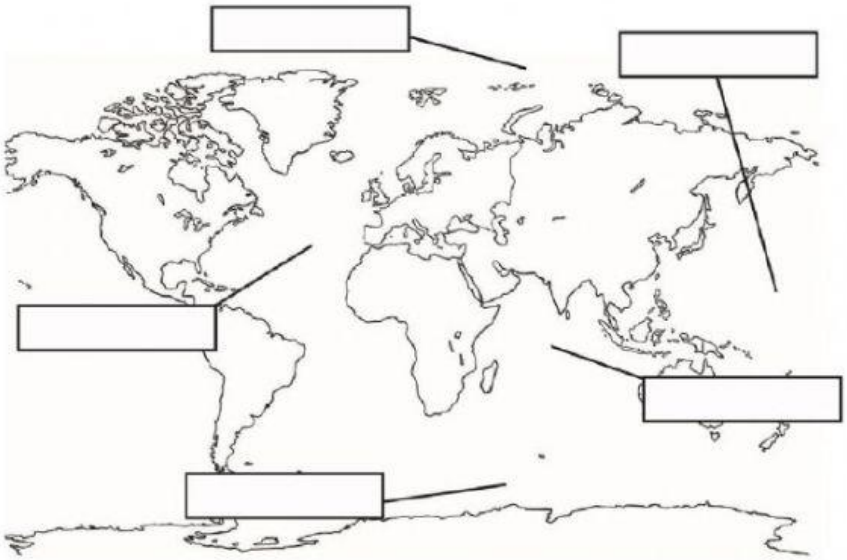

Word Bank

Pacific Ocean

Arctic Ocean

Indian Ocean

Atlantic Ocean

Southern Ocean

LIVEWORKSHEETS

2nd Grade
Social Studies Exam
III Quarter

Look at the pictures and write the name of each landmark.Use the word bank

El Picacho	Las Islas de la Bahia	Ruinas de Copan	Tegucigalpa

/

1. _____

2._____

3._____

4._____

LIVEWORKSHEETS