Masė

1.

24. Sujunkite rodyklėmis tuos skritulėlius, kuriuose surašytos masės yra lygios.

a)

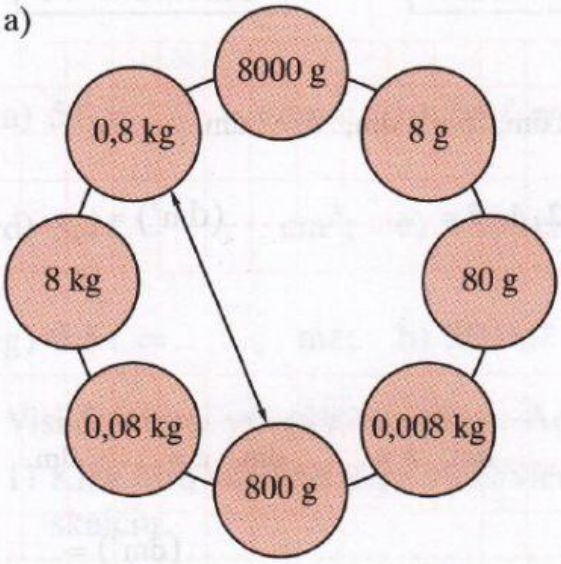

b)

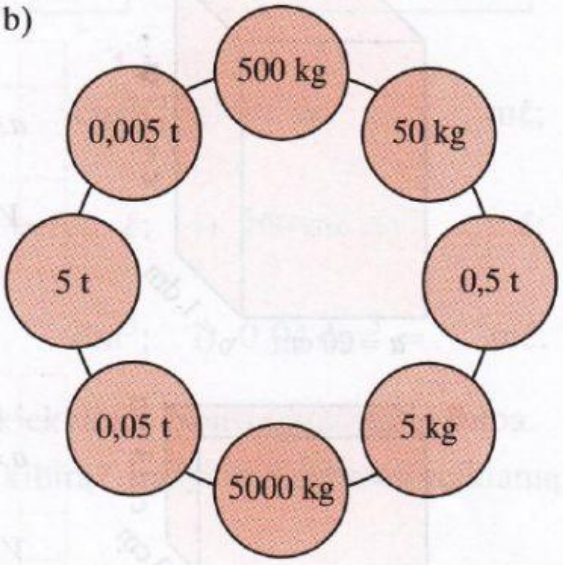

2. Apskaičiuokite.

a)



= ..... = ... kg;

b)



= ..... = ... cnt;

c)

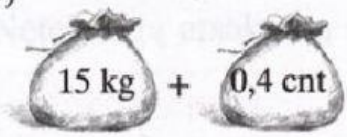

= ..... = ... kg;

d)



= ..... = ... cnt.

LIVEWORKSHEETS

3. Užpildykite lentelę.

Medžiaga	1 cm^3 masė	Tūris	Masė
Aliuminis	2,7 g	2 cm^3	2 · 2,7 = ... g
Švinas	11,3 g	3 cm^3	= g
Ledas	0,9 g	5 cm^3	= g
Kamštis	0,127 g	100 cm^3	= g

4. Apskaičiuokite pavaizduoto stačiakampio gretasienio formos ąžuolinio tašelio masę. (1 cm^3 ąžuolo masė lygi 0,8 g.)

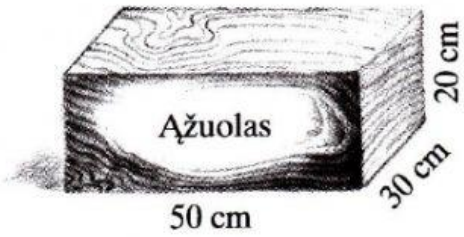

Skaičiavimams:

Tašelio tūris lygus ..... $V_{Ąžuolinio}$ = . cm^3.

Tašelio masė lygi ..... Masė $_{Ąžuolinio}$ = ... g.

5. 1 cm^3 aukso sveria 19,3 g. 1 cm^3 sidabro sveria 10,5 g. Pažymėkite tą stačiakampio gretasienio formos gabalėlį, kurio masė didesnė.

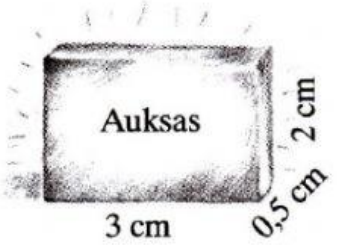

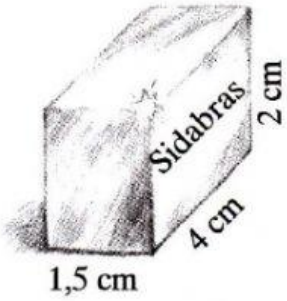

$V_{Sidabrinio}$ = cm^3

Masė $_{Sidabrinio}$ = g

$V_{Auksinio}$ = cm^3

Masė $_{Auksinio}$ = g

Įsivertinkite:

LIVEWORKSHEETS