Multiplying Fractions by Whole Numbers

Use the diagrams to help you solve the equations below. You do not need to simplify your answers.

Example:

$\frac{1}{3} \times 4 =$  $= \frac{4}{3}$

1. $\frac{1}{2} \times 5 =$ $=$ ☐

2. $\frac{1}{4} \times 2 =$ $=$ ☐

3. $\frac{1}{3} \times 3 =$ 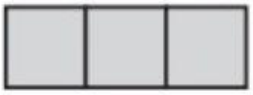 $=$ ☐

4. $\frac{1}{6} \times 4 =$ 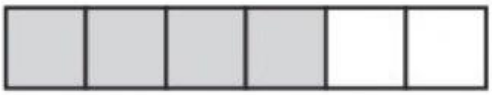 $=$ ☐

5. $\frac{1}{3} \times 2 =$  $=$ ☐

6. $\frac{1}{4} \times 6 =$ $=$ ☐

7. $\frac{1}{2} \times 3 =$  $=$ ☐

8. $\frac{1}{8} \times 2 =$ 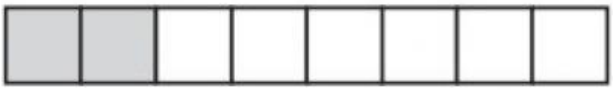 $=$ ☐

9. $\frac{1}{6} \times 2 =$  $=$ ☐

10. $\frac{1}{3} \times 5 =$  $=$ ☐

LIVEWORKSHEETS