Calcola il valore di ogni frazione aiutandoti con il disegno.

$\frac{2}{5}$ di 10 =

$\frac{3}{4}$ di 12 =

$\frac{7}{8}$ di 16 =

$\frac{5}{9}$ di 18 =

Calcola il valore di ogni frazione e colora la parte corrispondente



$\frac{3}{8}$ di 24 → ..... : ..... = ...

→ ..... x ..... = ...

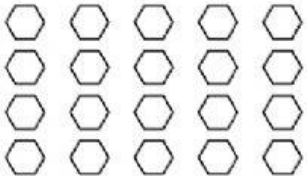

$\frac{3}{4}$ di 20 → ..... : ..... = ...

→ ..... x ..... = ...



$\frac{4}{7}$ di 28 → ..... : ..... = ...

→ ..... x ..... = ...



$\frac{5}{8}$ di 32 → ..... : ..... = ...

→ ..... x ..... = ...

Clicca solo sulle frazioni improprie, cioè quelle che rappresentano più di 1 intero

$\frac{2}{3}$ $\frac{4}{6}$ $\frac{16}{4}$ $\frac{3}{8}$ $\frac{21}{3}$ $\frac{5}{12}$ $\frac{3}{9}$

Completa in modo da ottenere frazioni improprie

$\frac{...}{6}$ $\frac{9}{...}$ $\frac{2}{...}$ $\frac{10}{...}$ $\frac{...}{15}$ $\frac{7}{...}$ $\frac{...}{3}$

calcola le frazioni equivalenti come nell'esempio

$\frac{1}{5} = \frac{2}{10} = \frac{3}{15} = \frac{4}{_} = \frac{_}{25} = \frac{6}{_} = \frac{_}{35}$

$\frac{3}{7} = \frac{_}{14} = \frac{9}{_} = \frac{12}{_} = \frac{15}{_} = \frac{_}{42} = \frac{21}{_}$

$\frac{1}{4} = \frac{_}{8} = \frac{_}{12} = \frac{4}{_} = \frac{5}{_} = \frac{_}{24} = \frac{7}{_}$

$\frac{1}{2} = \frac{_}{4} = \frac{_}{6} = \frac{_}{8} = \frac{5}{_} = \frac{_}{12} = \frac{_}{14}$

LIVEWORKSHEETS