ESCUELA CARMEN GÓMEZ TEJERA
BIBLIOTECA ESCOLAR

FRACCIONES

Instrucciones: Coloca cada fracción con la figura que la representa.

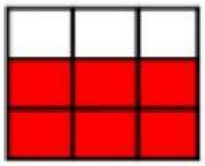


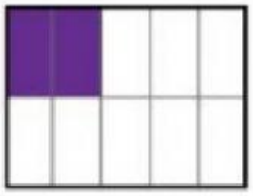

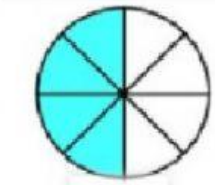
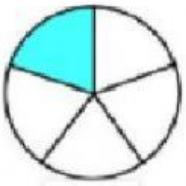
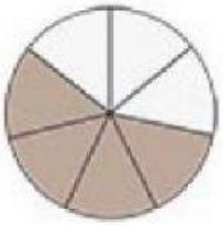

$\frac{6}{8}$ $\frac{2}{5}$ $\frac{2}{6}$ $\frac{1}{5}$ $\frac{2}{10}$ $\frac{6}{9}$ $\frac{4}{7}$ $\frac{4}{8}$

LIVEWORKSHEETS