1.Represent the information from the table by clicking at happy faces)

FAVORITE ANIMALS OF CLASS 5A12				
Animals	cat	hamster	dog	fish
Numbers	3	12	15	6



= 3 animals

LIVEWORKSHEETS

Use the information to answer questions

Club	Number of students
English	10
Maths	2
Dancing	8
Vietnamese	6

2. Which club has the most students?

A. English **B.Maths** **C. Dancing**

3. How many more students joining in English club than Vietnamese club?

A. 4 **B. 6** **C.8**

LIVEWORKSHEETS



4.How many votes are there for volleyball? _____

5. What is the difference between the sports with the most votes and fewest votes?_____

6. If each student voted once, how many students voted in total?_____

7. Which statement is Correct?

A. There are 4 votes for volleyball

B. 6 votes are for tennis and basketball

C. 8 people didn't vote for tennis

LIVEWORKSHEETS

Hanoians' cars in 2022

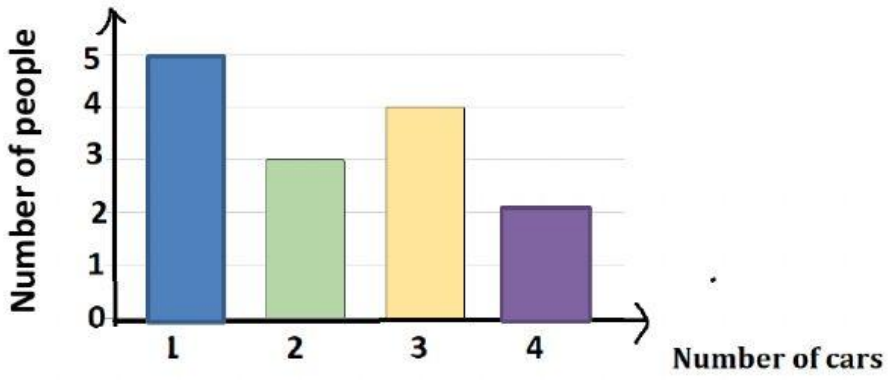

8.How many people have fewer than three cars?

9. How many people have fewer than two cars?

10. How many people have fewer than four cars?

11. How many students were surveyed in total?

LIVEWORKSHEETS