Name: _____

Date: _____

Score: _____

TEAM PRACTICE #2

GRAPHS & DATA

LABEL THE GRAPHS

Example: Q: What is the difference between cats and fish?

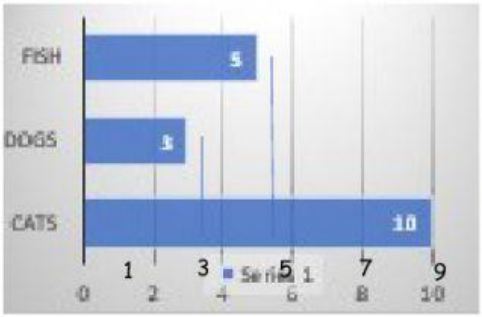

✓ Find the Key = By 1

✓ Label the Graphs = Fish 5, Dogs3, Cats 10

✓ Number Sentence= 10-5= 5

Q: What was the difference between Sunny and Rainy days? ____

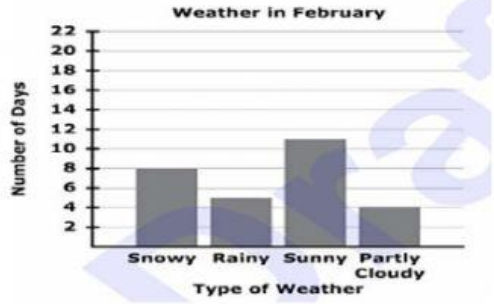

FK=

LG=

NS

Q: What was the total of Sunny and Snowy days? ____



FK=

LG=

NS

Q: What was the total of students going to the field Trip? ____

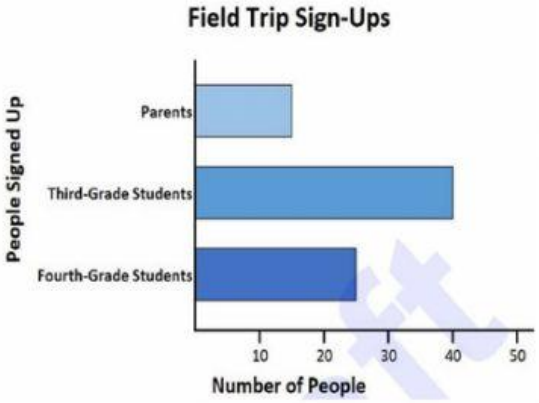

FK=

LG=

NS

LIVEWORKSHEETS

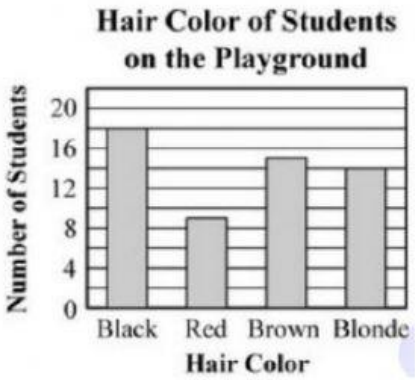

Q: How many more students has their hair color black, than red? ____

FK=

LG=

NS

Q: How many more minutes did Micah practice on Friday and Monday than Tuesday? ____

Minutes Micah Practiced Last Week

Day of Week	Minutes of Practice
Monday	♫ ♫ ♫
Tuesday	♫ ♫
Wednesday	♫ ♫ ♫ ♫
Thursday	♫ ♫ ♫
Friday	♫ ♫ ♫ ♫ ♫ ♫
Saturday	♫ ♫ ♫ ♫ ♫
Sunday	♫

♫ = 10 minutes

FK=

LG=

NS

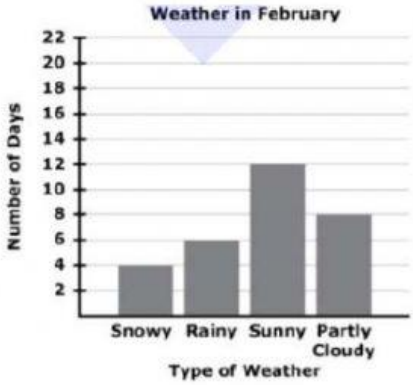

Q: What was the difference between Party Cloudy and Snowy days? ____

FK=

LG=

NS

Q: How many more Sunny and Rainy than Snowy were recorded in the Graph? ____

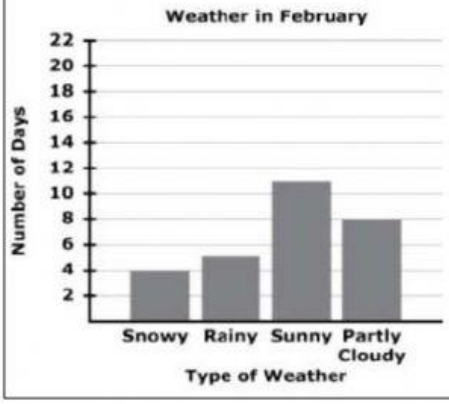

FK=

LG=

NS

LIVEWORKSHEETS

Name: _____

Date: _____

Score: _____

TEAM PRACTICE #2

GRAPHS & DATA

LABEL THE GRAPHS

Example: Q: What is the difference between cats and fish?

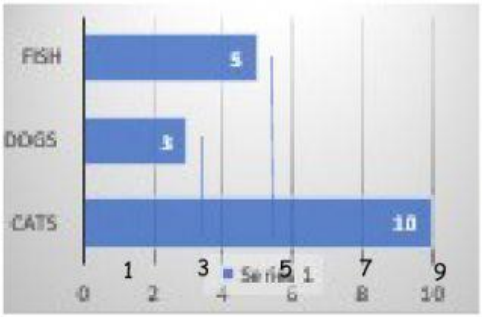

✓ Find the Key = By 1

✓ Label the Graphs = Fish 5, Dogs3, Cats 10

✓ Number Sentence= 10-5= 5

Q: What was the difference between Sunny and Rainy days? ____

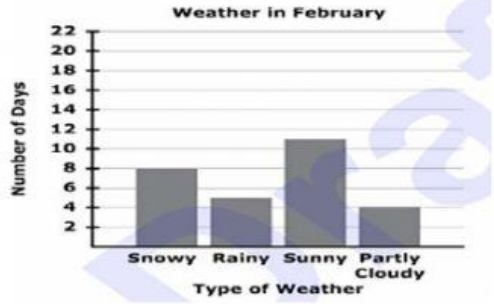

FK=

LG=

NS

Q: What was the total of Sunny and Snowy days? ____



FK=

LG=

NS

Q: What was the total of students going to the field Trip? ____

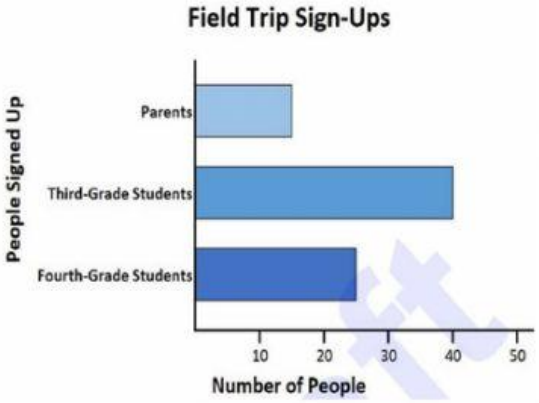

FK=

LG=

NS

LIVEWORKSHEETS

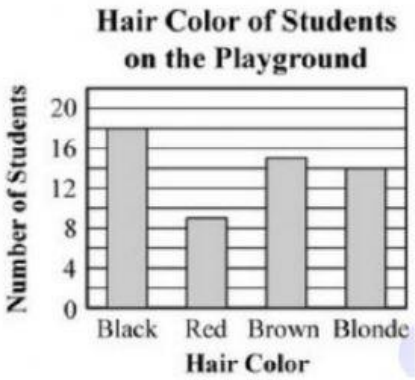

Q: How many more students has their hair color black, than red? ____

FK=

LG=

NS

Q: How many more minutes did Micah practice on Friday and Monday than Tuesday? ____

Minutes Micah Practiced Last Week

Day of Week	Minutes of Practice
Monday	♫ ♫ ♫
Tuesday	♫ ♫
Wednesday	♫ ♫ ♫ ♫
Thursday	♫ ♫ ♫
Friday	♫ ♫ ♫ ♫ ♫ ♫
Saturday	♫ ♫ ♫ ♫ ♫
Sunday	♫

♫ = 10 minutes

FK=

LG=

NS

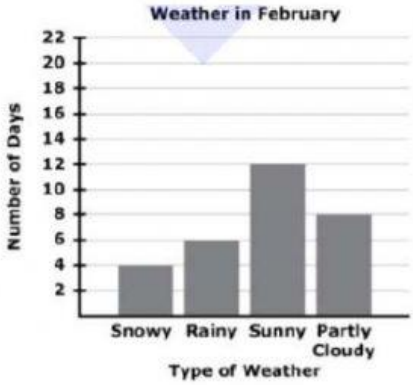

Q: What was the difference between Party Cloudy and Snowy days? ____

FK=

LG=

NS

Q: How many more Sunny and Rainy than Snowy were recorded in the Graph? ____

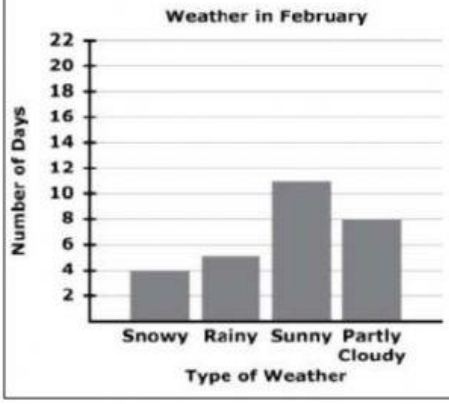

FK=

LG=

NS

LIVEWORKSHEETS

Name: _____

Date: _____

Score: _____

TEAM PRACTICE #2

GRAPHS & DATA

LABEL THE GRAPHS

Example: Q: What is the difference between cats and fish?

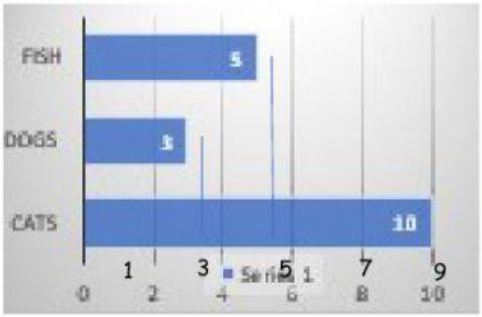

✓ Find the Key = By 1

✓ Label the Graphs = Fish 5, Dogs3, Cats 10

✓ Number Sentence= 10-5= 5

Q: What was the difference between Sunny and Rainy days? ____

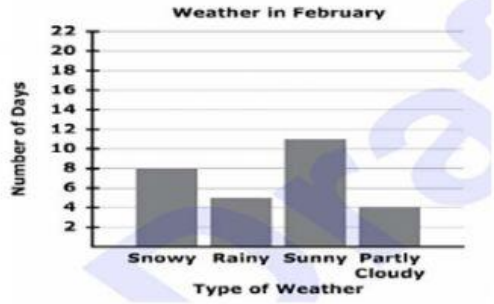

FK=

LG=

NS

Q: What was the total of Sunny and Snowy days? ____



FK=

LG=

NS

Q: What was the total of students going to the field Trip? ____

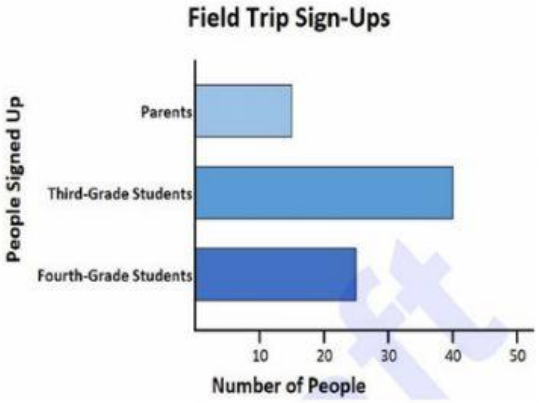

FK=

LG=

NS

LIVEWORKSHEETS

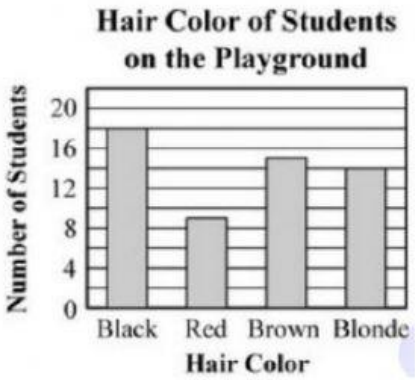

Q: How many more students has their hair color black, than red? ____

FK=

LG=

NS

Q: How many more minutes did Micah practice on Friday and Monday than Tuesday? ____

Minutes Micah Practiced Last Week

Day of Week	Minutes of Practice
Monday	♫ ♫ ♫
Tuesday	♫ ♫
Wednesday	♫ ♫ ♫ ♫
Thursday	♫ ♫ ♫
Friday	♫ ♫ ♫ ♫ ♫ ♫
Saturday	♫ ♫ ♫ ♫ ♫
Sunday	♫

♫ = 10 minutes

FK=

LG=

NS

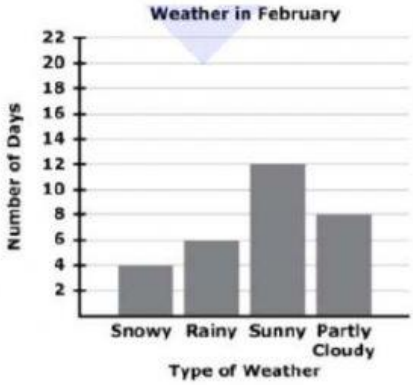

Q: What was the difference between Party Cloudy and Snowy days? ____

FK=

LG=

NS

Q: How many more Sunny and Rainy than Snowy were recorded in the Graph? ____

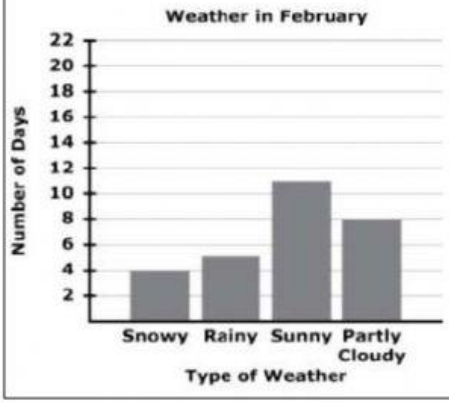

FK=

LG=

NS

LIVEWORKSHEETS

Name: _____

Date: _____

Score: _____

TEAM PRACTICE #2

GRAPHS & DATA

LABEL THE GRAPHS

Example: Q: What is the difference between cats and fish?

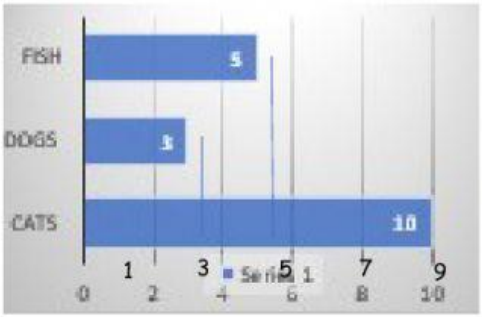

✓ Find the Key = By 1

✓ Label the Graphs = Fish 5, Dogs3, Cats 10

✓ Number Sentence= 10-5= 5

Q: What was the difference between Sunny and Rainy days? ____

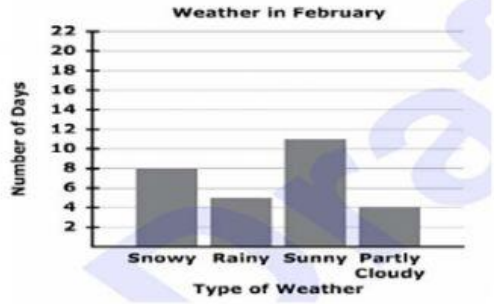

FK=

LG=

NS

Q: What was the total of Sunny and Snowy days? ____



FK=

LG=

NS

Q: What was the total of students going to the field Trip? ____

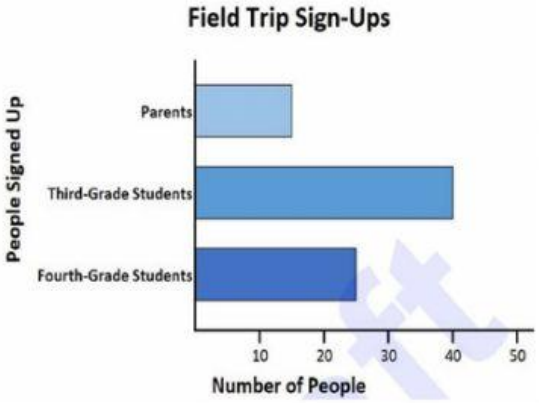

FK=

LG=

NS

LIVEWORKSHEETS

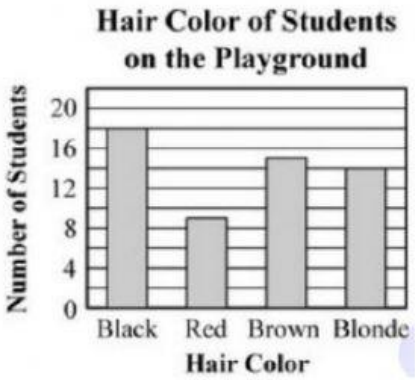

Q: How many more students has their hair color black, than red? ____

FK=

LG=

NS

Q: How many more minutes did Micah practice on Friday and Monday than Tuesday? ____

Minutes Micah Practiced Last Week

Day of Week	Minutes of Practice
Monday	♫ ♫ ♫
Tuesday	♫ ♫
Wednesday	♫ ♫ ♫ ♫
Thursday	♫ ♫ ♫
Friday	♫ ♫ ♫ ♫ ♫ ♫
Saturday	♫ ♫ ♫ ♫ ♫
Sunday	♫

♫ = 10 minutes

FK=

LG=

NS

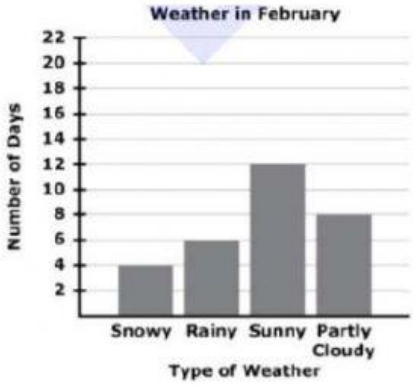

Q: What was the difference between Party Cloudy and Snowy days? ____

FK=

LG=

NS

Q: How many more Sunny and Rainy than Snowy were recorded in the Graph? ____

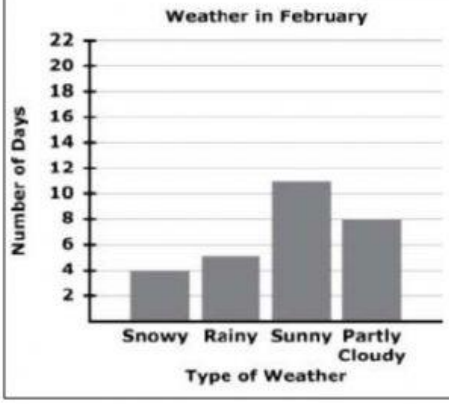

FK=

LG=

NS

LIVEWORKSHEETS

Name: _____

Date: _____

Score: _____

TEAM PRACTICE #2

GRAPHS & DATA

LABEL THE GRAPHS

Example: Q: What is the difference between cats and fish?

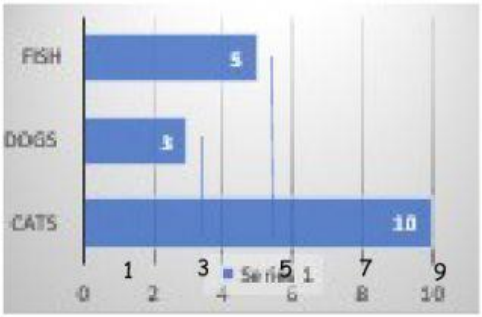

✓ Find the Key = By 1

✓ Label the Graphs = Fish 5, Dogs3, Cats 10

✓ Number Sentence= 10-5= 5

Q: What was the difference between Sunny and Rainy days? ____

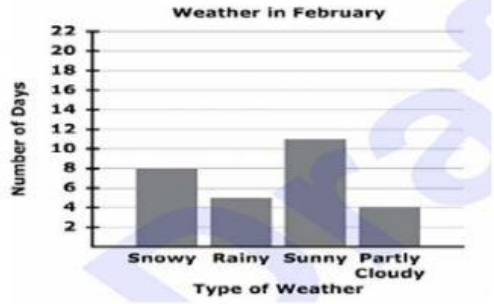

FK=

LG=

NS

Q: What was the total of Sunny and Snowy days? ____



FK=

LG=

NS

Q: What was the total of students going to the field Trip? ____

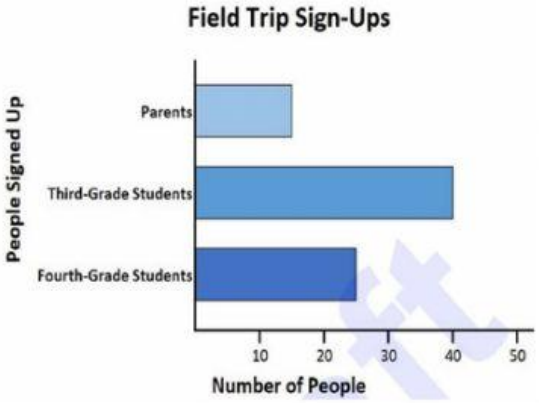

FK=

LG=

NS

LIVEWORKSHEETS