Rozhodni, zda se jedná o funkci či nikoliv.

Pokud ano, urči definiční obor a obor hodnot pomocí intervalů.

∞ zapiš slovy např. (-nekonečno; 4> Sjednocení zapiš jako $\cup$

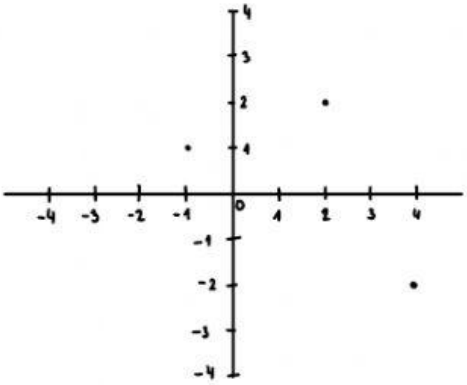

Funkce ANO NE

$D_f \in$

$H_f \in$

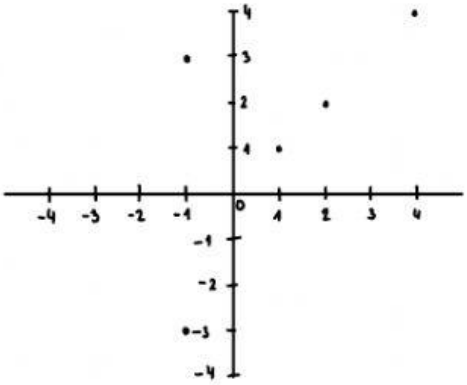

Funkce ANO NE

$D_f \in$

$H_f \in$

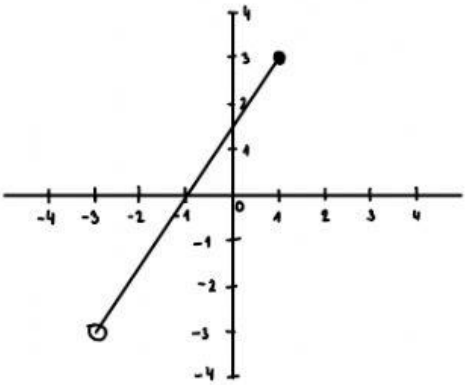

Funkce ANO NE

$D_f \in$

$H_f \in$

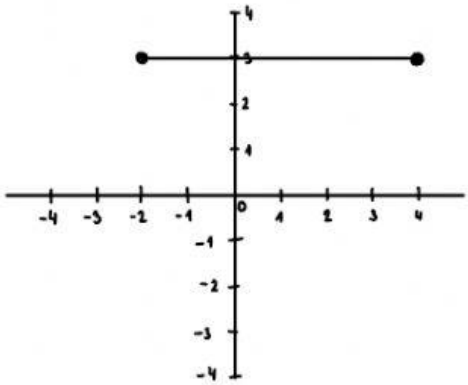

Funkce ANO NE

$D_f \in$

$H_f \in$

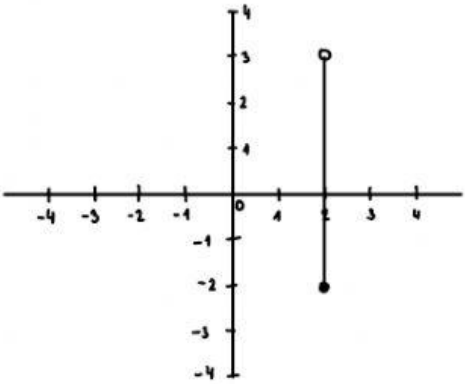

Funkce ANO NE

$D_f \in$

$H_f \in$

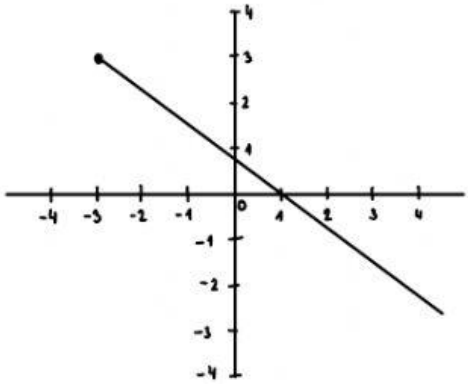

Funkce ANO NE

$D_f \in$

$H_f \in$

LIVEWORKSHEETS

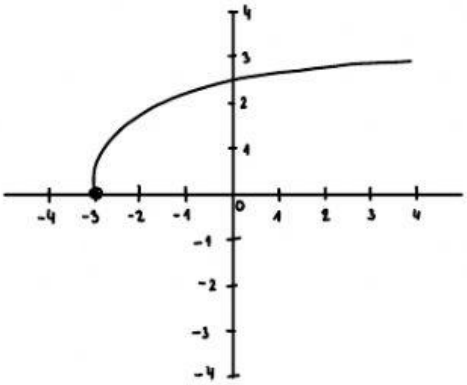

Funkce ANO NE

$D_f \in$

$H_f \in$

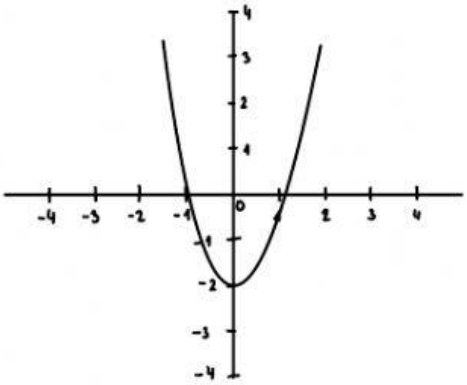

Funkce ANO NE

$D_f \in$

$H_f \in$

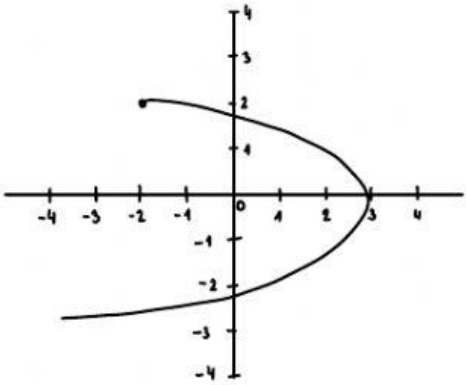

Funkce ANO NE

$D_f \in$

$H_f \in$

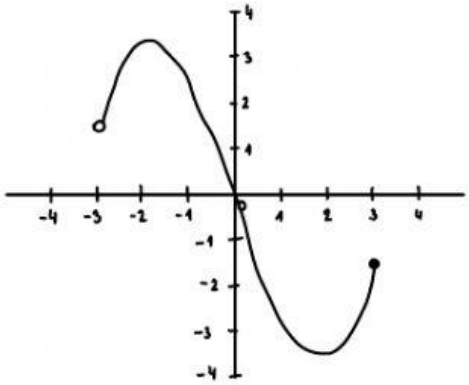

Funkce ANO NE

$D_f \in$

$H_f \in$

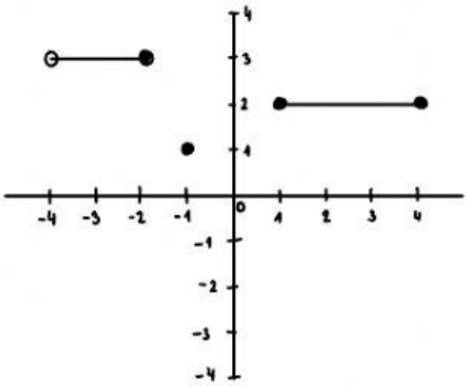

Funkce ANO NE

$D_f \in$

$H_f \in$

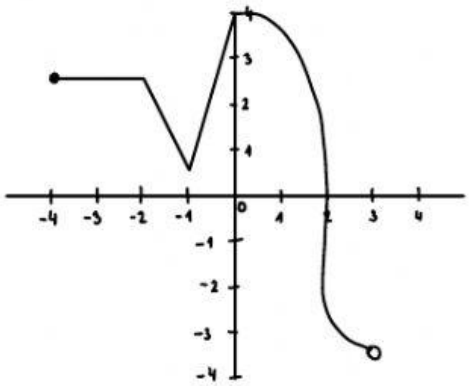

Funkce ANO NE

$D_f \in$

$H_f \in$

LIVEWORKSHEETS