1. Prismas o pirámides

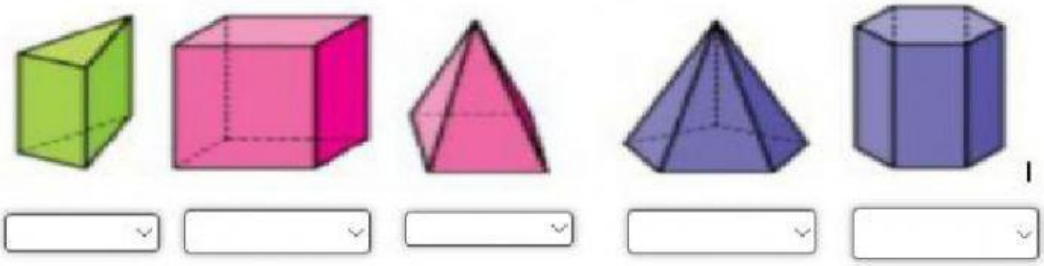

2. ¿Cómo se llaman estos poliedros?

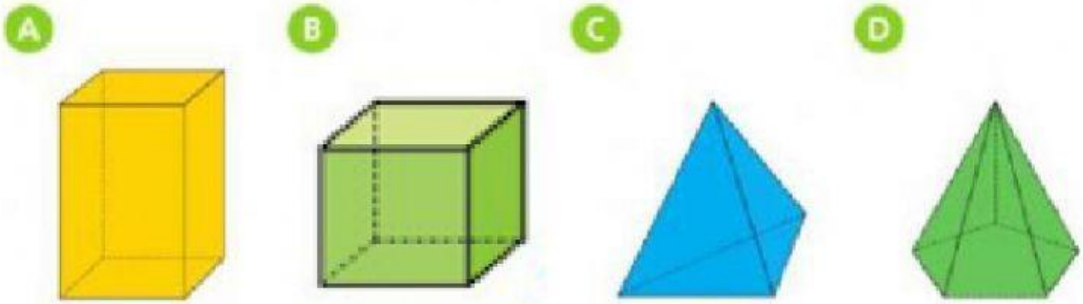

A :

C:

B:

D:

3. Cuenta las caras, aristas y vértices de las figuras:

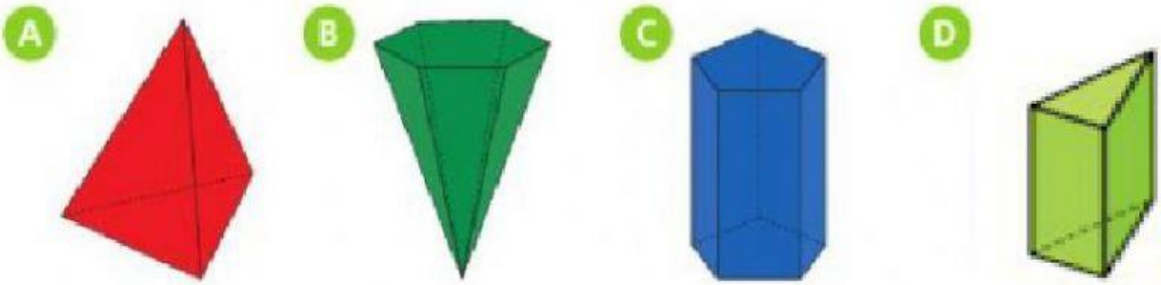

FIGURA A	Caras:	Vértices:	Aristas:
FIGURA B	Caras:	Vértices:	Aristas:
FIGURA C	Caras:	Vértices:	Aristas:
FIGURA D	Caras:	Vértices:	Aristas: