My name is _____

Unit 7 & Unit 12 revision.

1. Choose the correct month of the year:

Which month is **after** February?	May	July	March
Which month is **before January**?	December	January	May
Which month is **before** July?	October	June	August
Which month is **after** August?	September	April	December

2. Fill in the missing numbers.

1 hour = **60** minutes	1 day = _____ hours
1 week = _____ days	1 month = _____ weeks
1 year = _____ months	1 minute = _____ seconds

3. Use the calendar to answer the questions.
Write the ordinal number:

JANUARY						
S	M	T	W	T	F	S
		1	2	3	4	5
6	7	8	9	10	11	12
13	14	15	16	17	18	19
20	21	22	23	24	25	26
27	28	29	30	31		

What is the first Tuesday in January?	
What is the first Friday in January?	
What is the last Sunday in January?	
What is the second Thursday of January?	

JANUARY						
S	M	T	W	T	F	S
		1	2	3	4	5
6	7	8	9	10	11	12
13	14	15	16	17	18	19
20	21	22	23	24	25	26
27	28	29	30	31		

Example: Friday 18th November

_____ _____ _____
(Day) (Date) (Month)

4. Write the date that is circled;

5. Match the analogue clock to the digital clock:

LIVEWORKSHEETS

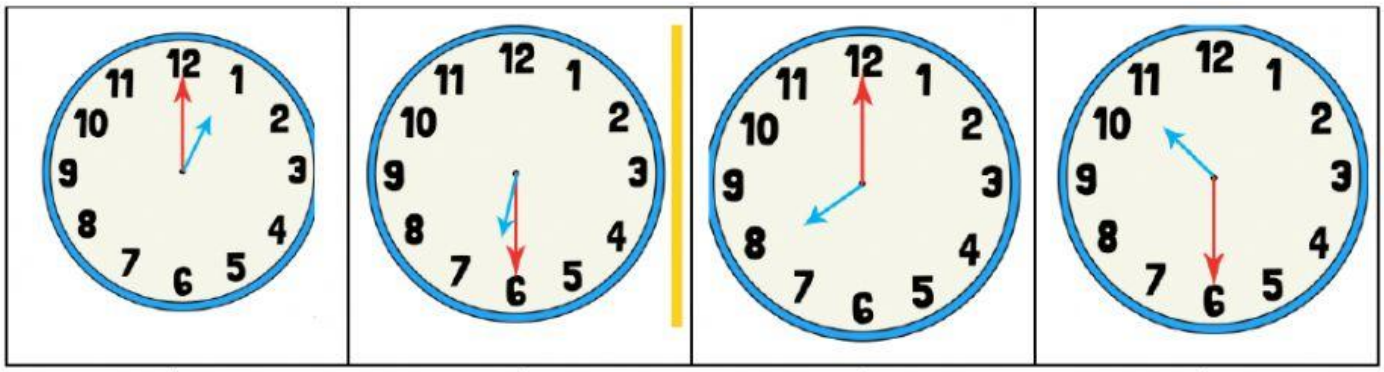

* * * *

* * * *

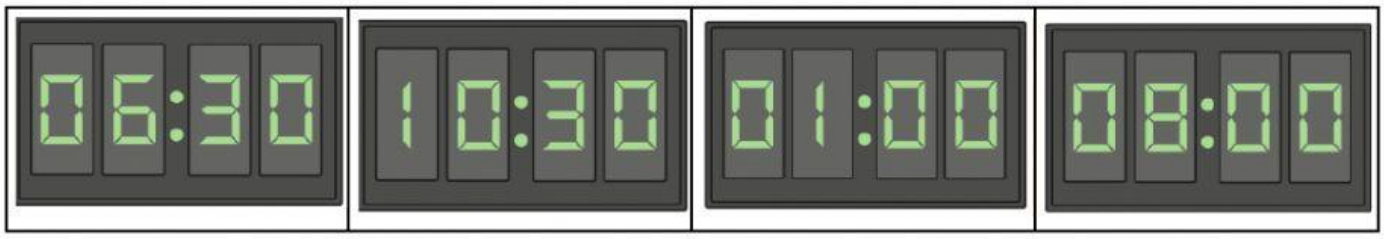

5. Match the analogue clocks to the time in words:

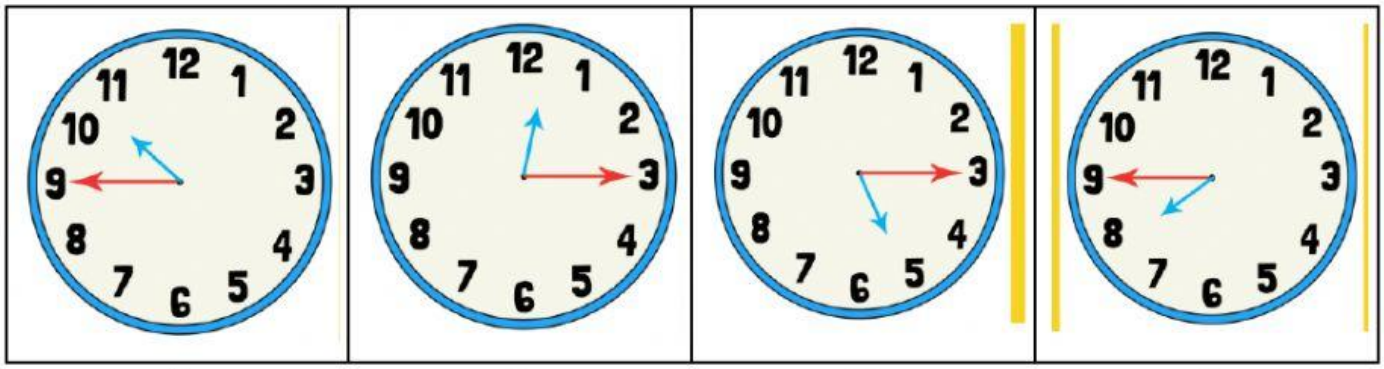

* * * *

* * * *

quarter past twelve	quarter past five	quarter to eleven	quarter to eight

LIVEWORKSHEETS

6. Choose the correct time of day

I go to bed. 	Morning Afternoon Evening	*I go to school.* 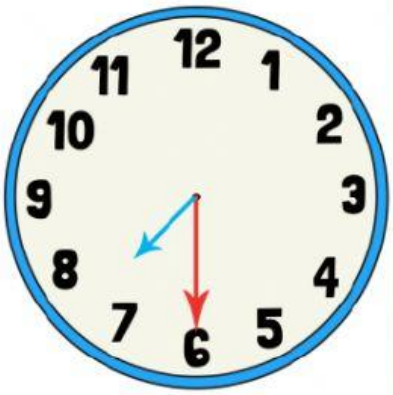	Morning Afternoon Evening

7. Choose the correct digital time to match the analogue clock

3:35 3:40 3:55 4:35	4:10 4:50 7:10 4:40
11:01 11:50 6:05 10:45	2:25 2:20 2:05 2:25

LIVEWORKSHEETS

LIVEWORKSHEETS