ПЕРИМЕТР РІВНОБЕДРЕНОГО ТРИКУТНИКА

ЗАВДАННЯ: *Знайдіть невідомі елементи в трикутнику*

1

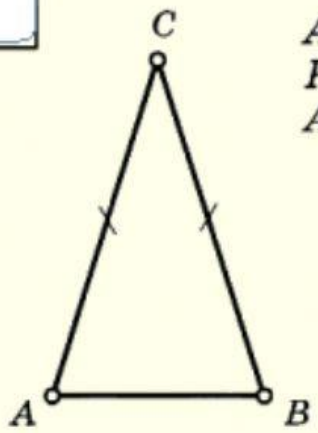

$AC = 2\,AB$
$P = 20$
AC, BC, AB — ?

AC = ☐
BC = ☐
AB = ☐

3

$P = 35$
$EF : EM = 3 : 2$
EF, EM, MF — ?

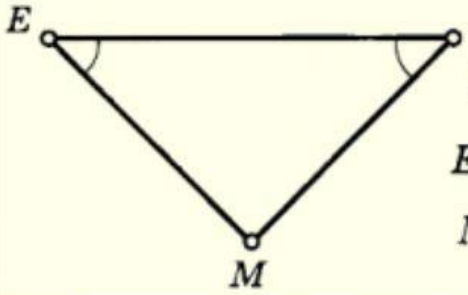

EF = ☐
EM = ☐
MF = ☐

2

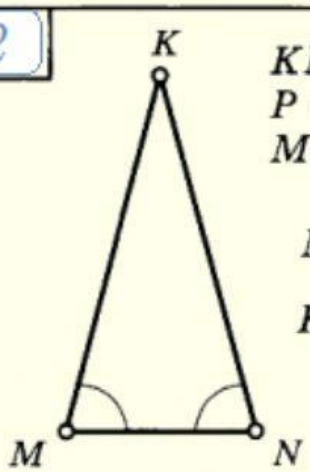

$KM - MN = 10$
$P = 26$
MK, KN, MN — ?

MK = ☐
KN = ☐
MN = ☐

4

$P = 3{,}4;\ BC = 1{,}3$
AB — ?

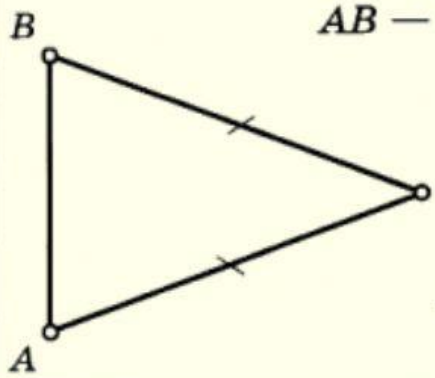

AB = ☐

LIVEWORKSHEETS