Събирам и изваждам

Запиши и пресметни така, както е показано на образеца

Изваждане

6 − 1 = 5

□○□○□



□○□○□

□○□○□

Събиране

□○□○□

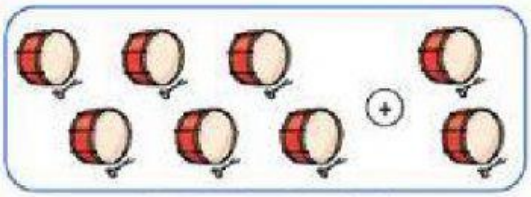

□○□○□

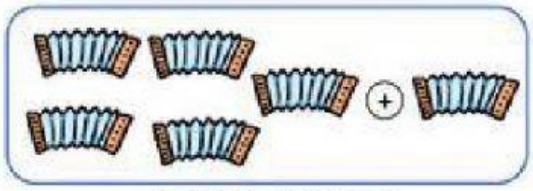

□○□○□

□○□○□

Свържи всяка калинка с нейната сянка



Попълни липсващото число



1		3	4	
	7		9	

2	10	8	5	6