Lembaran Kerja 3

Nama: _____ Kelas: _____

A) Tuliskan ukuran panjang bagi objek di bawah.

1	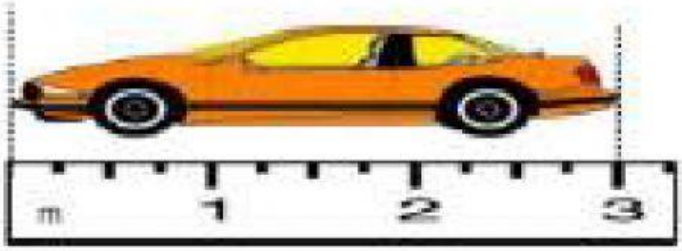	= _____
2	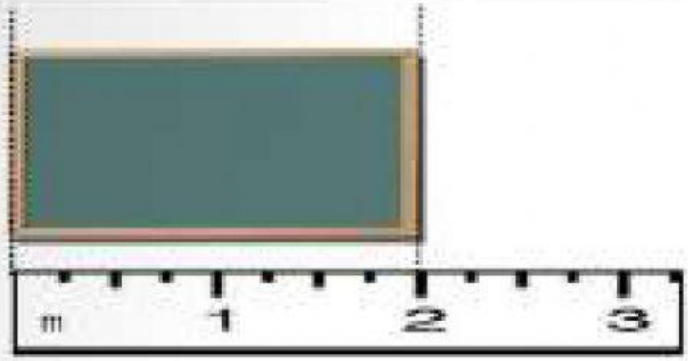	= _____
3		= _____

LIVEWORKSHEETS