C Based on the diagrams below, state the volumes of liquids.

1.



_____ mℓ

2.



_____ mℓ

3.



_____ mℓ

4.

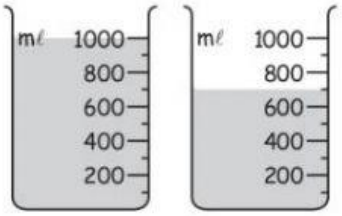

_____ ℓ _____ mℓ

5.

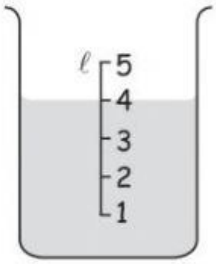

_____ ℓ

6.

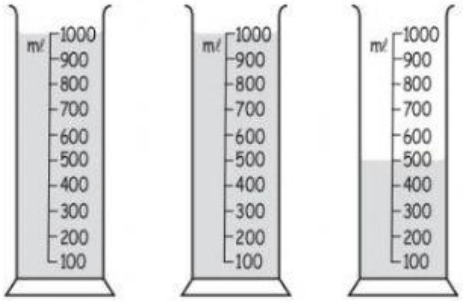

_____ ℓ _____ mℓ

LIVEWORKSHEETS