C.E.B. NO GUBERNAMENTAL BILINGÜE MHOTIVO CHOLOMA

THIRD GRADE A & B

2022 – 2023

II PARTIAL MATH EVALUATION

Mrs. Liliana Mayorga/ Ms. Evelin Arita

Score: ____/25

Name: _____ **Date:** _____

MULTIPLICATION ON REPEATED ADDITION

Instruction: Add and multiply the numbers. Count the shapes. 2% each one (10%)

1 	$2 + 2 + 2$ = _____	$3 \times 2 =$ _____
2 	$3 + 3 + 3$ = _____	$3 \times 3 =$ _____
3 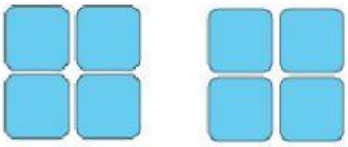	$4 + 4$ = _____	$2 \times 4 =$ _____
4 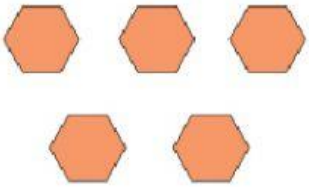	$1 + 1 + 1 + 1 + 1$ = _____	$5 \times 1 =$ _____
5 	$6 + 6 + 6 + 6$ = _____	$4 \times 6 =$ _____

LIVEWORKSHEETS

C.E.B. NO GUBERNAMENTAL BILINGÜE MHOTIVO CHOLOMA

THIRD GRADE A & B

2022 – 2023

II PARTIAL MATH EVALUATION

Mrs. Liliana Mayorga/ Ms. Evelin Arita

Score: ____/25

Name: _____ **Date:** _____

Instruction: Count 2 by 2, 3 by 3, 4 by 4 and 5 by 5
3% each one. (15%)

Count by 2s	Count by 3s	Count by 4s	Count by 5s	Count by 6s
2	3	4	5	6
4	6	8	10	12

LIVEWORKSHEETS