Exercise 2 (remember to include units in your answer – cm^2, m^2, km^2)

Work out the area of the following squares and rectangles
(remember to include units in your answer)

1) 4cm by 8cm **2)** 9cm by 7cm **3)** 2·5m by 2·5m

4) 3·6km by 5km **5)** 24cm by 16cm **6)** 1·25m by 1·25m

7) 100m by 3·2m **8)** 4·9m by 97·2cm **9)** 6mm by 7·2m

Exercise 3 (remember to include units in your answer: cm^2, m^2, km^2)

Using the rule **Area of Triangle =** $\frac{1}{2}$ **x base x height**, find the area of the following triangles (all lengths are in cm)

1)

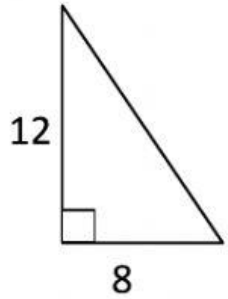

2)

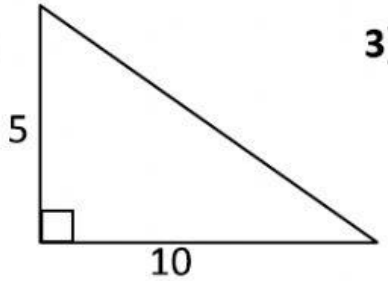

3)

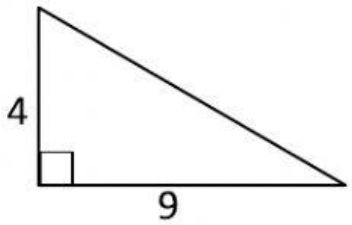

4)

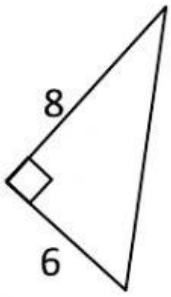

5)

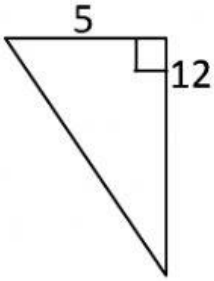

6)

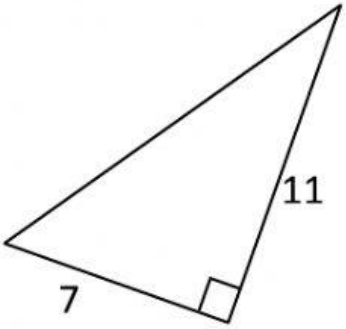

7)

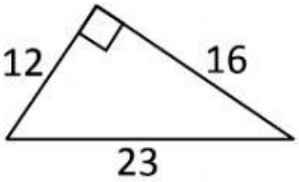

8)

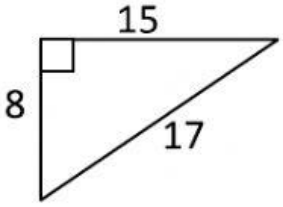

9)

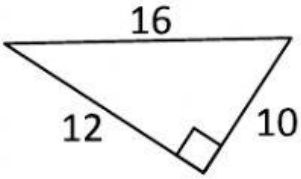

LIVEWORKSHEETS

10)

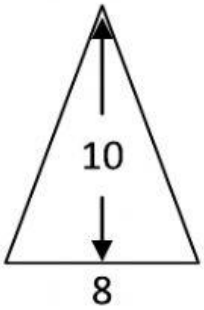

11)

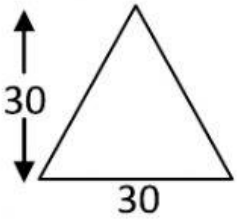

12)

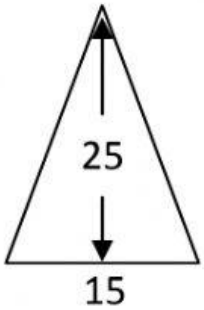

13)

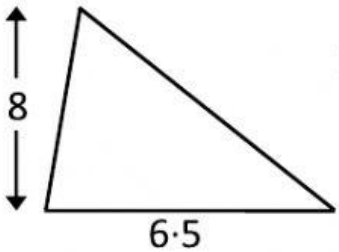

14)

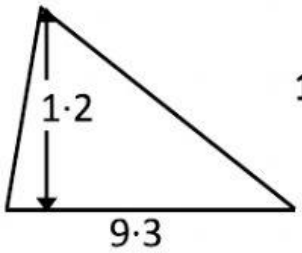

15)

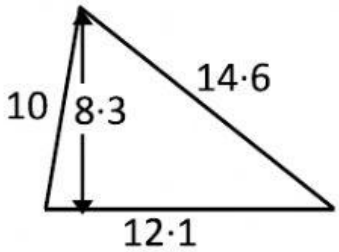

16)

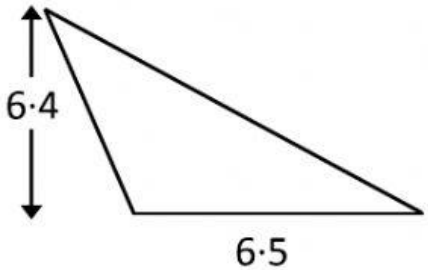

18)

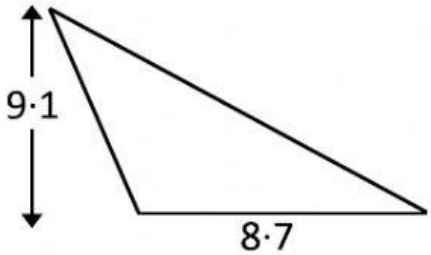

19)

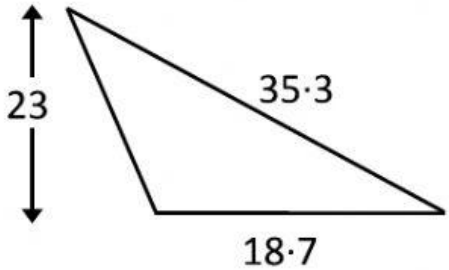

20)

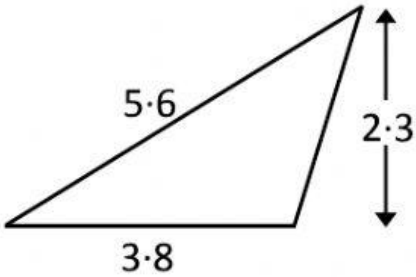

LIVEWORKSHEETS