OPERACIONES DE FUNCIONES

$f(x) = 2x$ $g(x) = 3x+2$ $h(x) = -2x-5$

Realiza, las siguientes operaciones, en el primer rectángulo sustituye la operación que se indica y en el segundo coloca el resultado

$5f(x) =$ _____ = _____

$h(x) - g(x) =$ _____ = _____

$g(x)f(x) =$ _____ = _____

$3h(x)+f(x)=$ _____ = _____

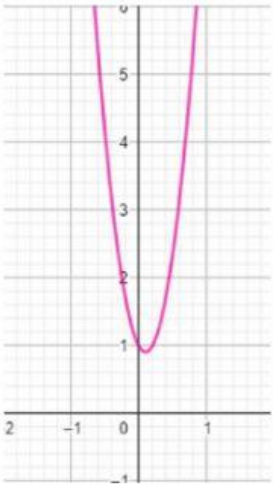

$6x^2 + 4x$ $-5x - 7$ $-4x - 15$ $10x$

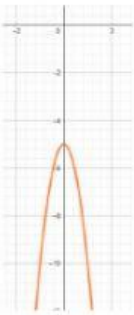



LIVEWORKSHEETS