LEMBAR KERJA PESERTA DIDIK

Mata Pelajaran : **Matematika**

Kelas : **V (Lima)**

Nama : .....

A. Tentukan Volume Kubus di bawah ini !

1.

Volume = ____ cm^3

3.

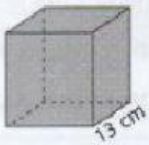

Volume = ____ cm^3

5.

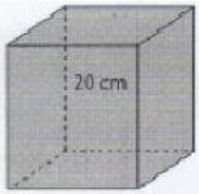

Volume = ____ cm^3

2.

Volume = ____ cm^3

4.

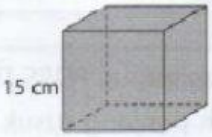

Volume = ____ cm^3

6.

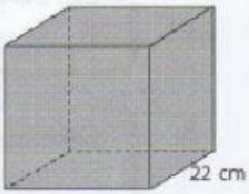

Volume = ____ cm^3

B. Tentukan Volume Balok di bawah ini!

1.

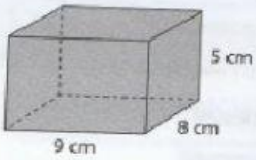

Volume = ____ cm^3

3.

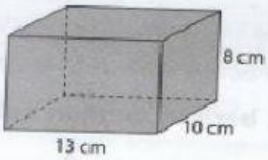

Volume = ____ cm^3

5.

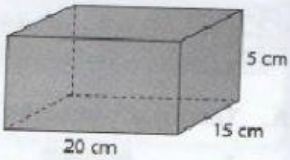

Volume = ____ cm^3

2.

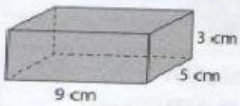

Volume = ____ cm^3

4.

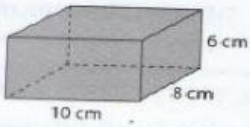

Volume = ____ cm^3

6.

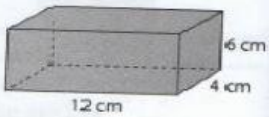

Volume = ____ cm^3

LIVEWORKSHEETS

C. Pindahkan besaran Volume Kubus dan Balok yang sesuai dengan gambar

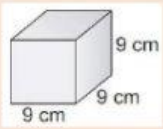	S= 11 Cm 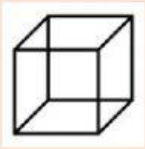	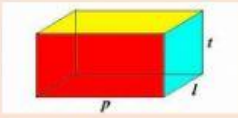 p :10 l:8 t:6	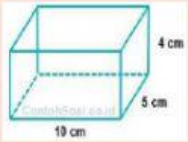
.....	.....	.....	.....
480 cm	200 cm	729 cm	1331 cm

D. Cocokan jawaban yang tepat di bawah ini

1	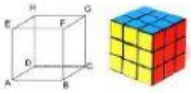	
2	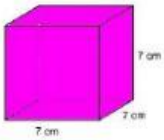	
3	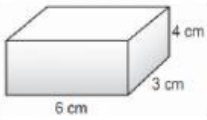	
4	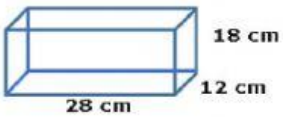	
5	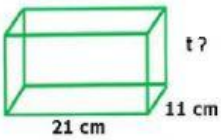 $V = 3927\ cm^3$	

A	72 Cm
B	6.048 Cm
C	27
D	17 Cm
E	343 Cm

LIVEWORKSHEETS

E. Isilah titik-titik di bawah ini dengan jawaban yang benar!

1. Adi membuat enam potongan kertas berbentuk persegi. Ukuran persegi tersebut adalah 10 cm. Adi merekatkannya menjadi kubus. Volum kubus yang dibuat Adi adalah ....
2. Sebuah bak penampungan air berbentuk kubus mempunyai panjang rusuk 85 cm. Volume bak penampungan air tersebut adalah . . . .
3. Iwan mempunyai kotak pensil. Kotak pensil tersebut panjangnya 20 cm, lebarnya 6 cm, dan tebalnya 3 cm. Volum kotak pensil tersebut adalah ....
4. Sebuah kotak berbentuk kubus memiliki volume 729 liter, maka panjang rusuk kotak tersebut adalah ... dm
5. Sebuah bak penampungan air berbentuk kubus mempunyai panjang rusuk 85 cm. Volume bak penampungan air tersebut adalah . . . .

Selamat Mengerjakan..

LIVEWORKSHEETS