a) Compare the mass of each pair and click on the heavier mass.

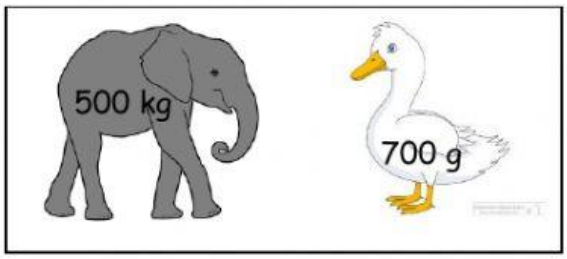

500 kilograms | 700 grams



600 grams | 6 kilograms

---

b) Look at the mass and choose the correct answer

The mass of the boy is

The mass of the walking stick is

---

c) Listen to the voice-over and state 'True' or 'False'

True | False

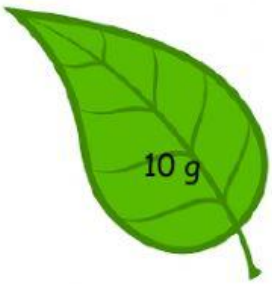

True | False

LIVEWORKSHEETS