IES. LAS NORIAS

Estructuras

Esforços 1

Indica que tipo de estructura es







LIVEWORKSHEETS

IES. LAS NORIAS

Nombra que tipo de esfuerzo esta aplicado a los elementos de las imágenes

Una estructura haurà de ser….(marca les respostes correctes)

- ☐ ….resistent
- ☐ …..gran
- ☐ ….rigida
- ☐ …..estable
- ☐ …..flexible

LIVEWORKSHEETS