IELTSMaterial.com
sachphotos.com

Practice Test 9

Instructions to follow

- Listen to the audio and answer the questions below

Part 1

Questions 1-5

Instructions to follow

- Complete the form below.
- Write NO MORE THAN TWO WORDS AND/ OR A NUMBER for each answer.

IELTSMaterial.com

Customer name: Mr ___(1)___

Daytime telephone number: ___(2)___

Telephone number after 5 pm as above (if no one answers, ___(3)___ a massage)

Number of guests: ___(4)___

Date: ___(5)___

Questions 6-8

Instructions to follow

- Complete the notes below.

LIVEWORKSHEETS

IELTSMaterial.com
sachphotos.com

Seating:

Shape ____6____

Size ____7____

Number of tables ____8____

Questions 9-10

Instructions to follow

- Circle the correct letter A - C.

IELTSMaterial.com

9 The main decides to book

A a three - course meal

B a buffet

A a banquet

10 The man will have to pay

A *E750 tomorrow

B *E100 per head

A *E1, 500 on the day of the party

LIVEWORKSHEETS

IELTSMaterial.com
sachphotos.com

Part 2

Questions 11-12

Instructions to follow

- Complete the notes below.
- Write NO MORE THAN THREE WORDS AND/OR A NUMBER for each answer.

Research details:

Title of project: _____ 11 _____

Focus of project: entertainment away from _____ 12 _____

Questions 13-16

IELTSMaterial.com

Instructions to follow

- Choose the correct letters A-C.

13 Which chart shows the percentage of cinema seats provided by the different cinema houses?

A ◯ Chart A

B ◯ Chart B

A ◯ Chart C

LIVEWORKSHEETS

IELTSMaterial.com
sachphotos.com

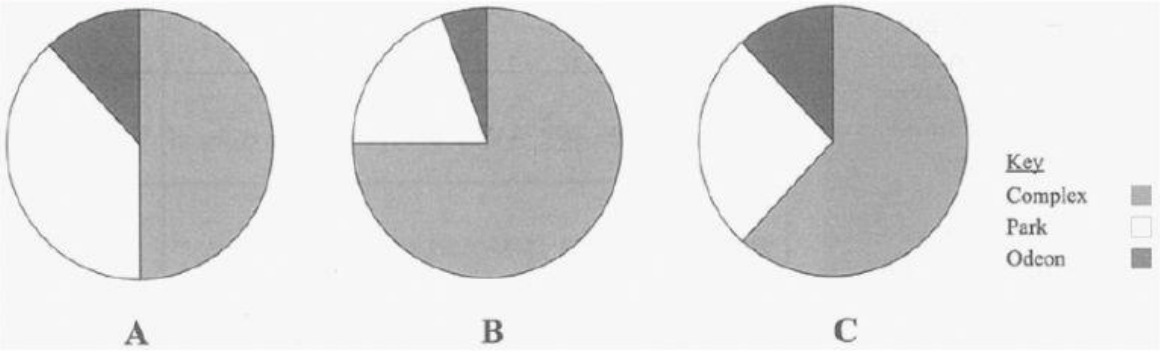

14 Which graph shows the relative popularity of different cinemas?

- A Graph A
- B Graph B
- A Graph C

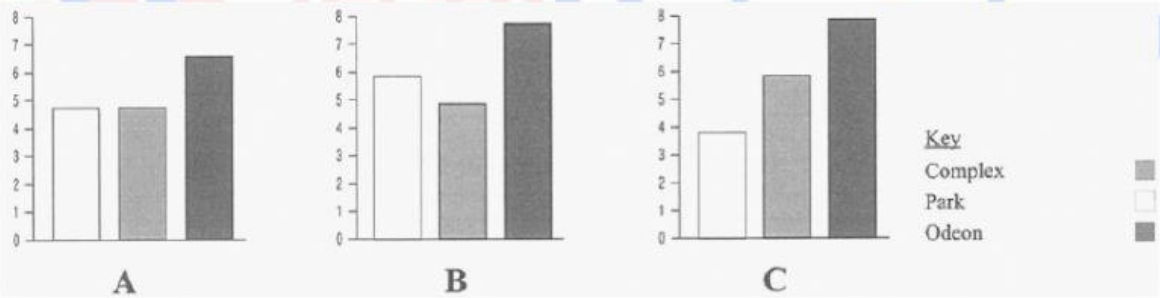

15 What did Rosie and Mike realise about the two theatres?

- A The prices were very similar
- B They were equally popular
- A They offered the same facilities

16 Which graph shows comparative attendance for cinema and theatre?

LIVEWORKSHEETS

IELTSMaterial.com
sachphotos.com

A Graph A

B Graph B

A Graph C

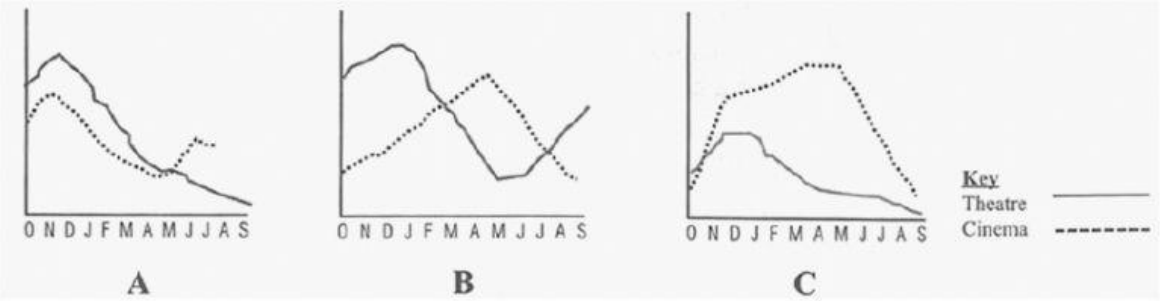

Questions 17-20

IELTSMaterial.com

Instructions to follow

- Choose the correct words in the list. Write NO MORE THAN TWO WORDS AND/ OR A NUMBER for each answer.

Complete the chart about the different music clubs below.

A Poor

B OK

C Excellent

Club	Type of music	Quality of venue

LIVEWORKSHEETS

IELTSMaterial.com
sachphotos.com

The Blues Club	Blues	17 _____
The Sansue	18 _____	Excellent
Pier Hotel	Folk	19 _____
Baldrock Cafe	Rock	20 _____

IELTSMaterial.com

LIVEWORKSHEETS

IELTSMaterial.com
sachphotos.com

Part 3

Questions 21-26

Instructions to follow

- Complete the notes below.
- Write NO MORE THAN TWO WORDS AND/ OR A NUMBER for each answer.

- 34 interviewed from .....21..... applicants nationally
- 13 chosen for a .....22..... training course in film-making
- .....23..... finalists selected as competitors
- produce a .....24..... video every two weeks
- no previous professional .....25..... experience allowed
- make their own .....26..... and obtain approval

Questions 27-28

Instructions to follow

- Circle the correct letter A-C.

27 What was Sarah price's worst experience during the trip ?

A ◯ she got lost in Mongolia.

B ◯ she was homesick.

A ◯ she got sick in a remote place.

LIVEWORKSHEETS

IELTSMaterial.com
sachphotos.com

28 In which of the following areas does Ray expect have most difficulty ?

A loneliness
B time pressure
A organisation skills

Questions 29-30

Instructions to follow

- Write NO MORE THAN TWO WORDS for each answer.

29 In what month does the Journey begin ?

.....

30 Name two things and are provided free of charge to the competitors

..... and .....

LIVEWORKSHEETS

IELTSMaterial.com
sachphotos.com

Part 4

Questions 31-33

Instructions to follow

- Answer the questions below.
- Write NO MORE THAN TWO WORDS for each answer.

31 In which part of London is the Tate Modern? The .....

32 What did the building the Tate Modern is in use to be? A .....

33 Work by whom is displayed on level 2 of the Tate Modern? .....

Questions 34-40

IELTSMaterial.com

Instructions to follow

- Complete the notes below.
- Write NO MORE THAN TWO WORDS AND/ OR A NUMBER for each answer.

*** Tate St. Ives**

Location:	Cornwall
Built on site of:	.....34.....
Housed in:	.....35.....
Opening date:	1993
Exhibits:	.....36..... including St Ives School

LIVEWORKSHEETS