LEMBAR KERJA
PESERTA DIDIK

Matematika

Kelas I

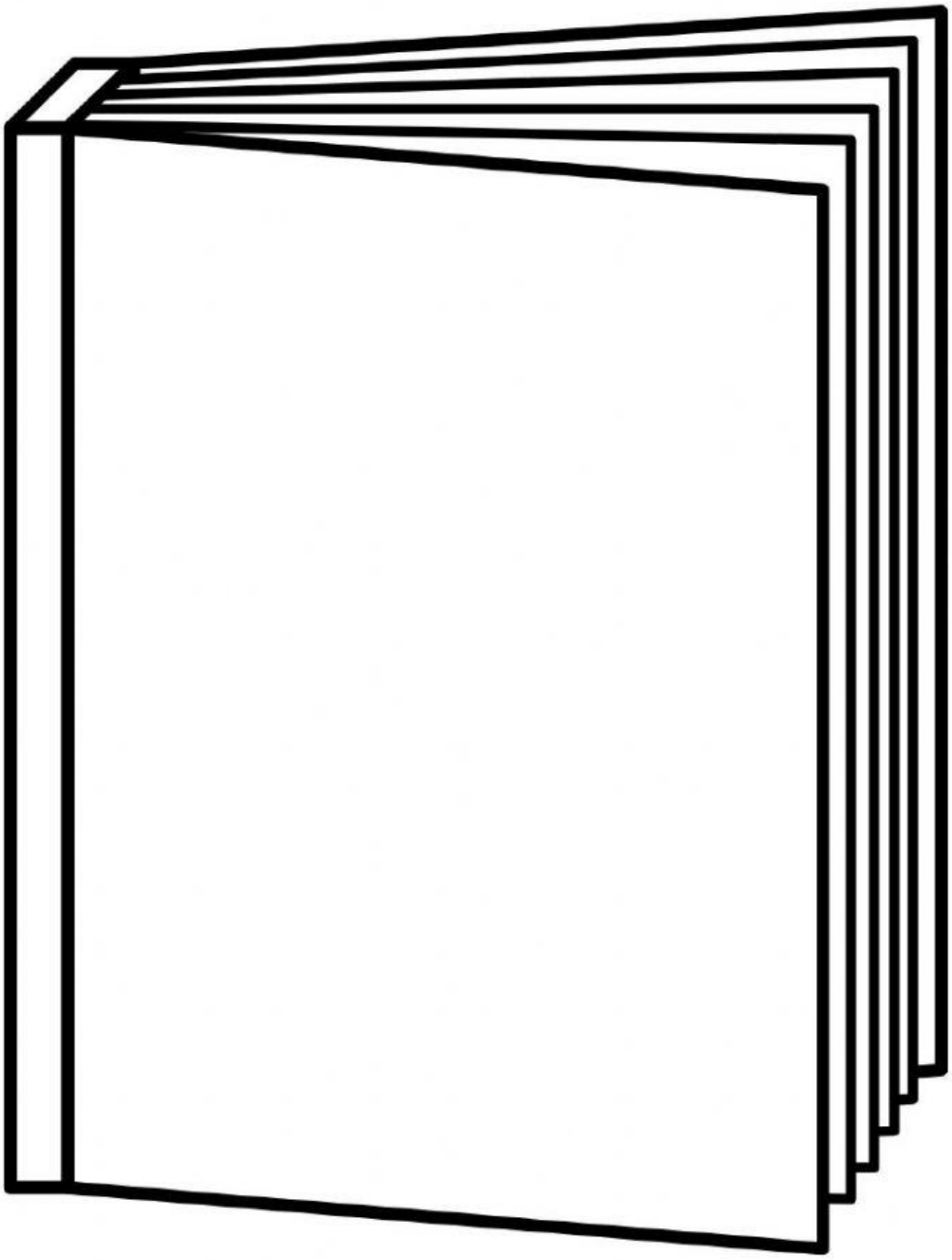

LIVEWORKSHEETS

BAB V
BENTUK - BENTUK BANGUN

Tujuan Pembelajaran

Setelah mempelajari materi ini siswa diharapkan dapat:

1. menebak benda benda yang termasuk bangun ruang
2. menebak benda benda yang termasuk bangun datar

LIVEWORKSHEETS

Nama : .....

Kelas : .....

No Absen : .....

Bangun Datar

Tuliskan nama bangun datar yang sesuai dengan benda-benda benda berikut di kolom yang sudah disediakan.

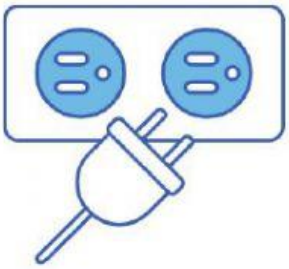

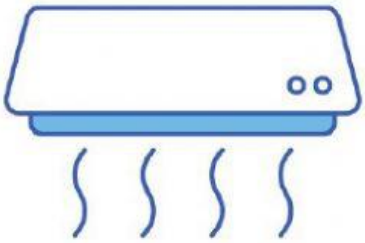

LIVEWORKSHEETS

Bangun Ruang

Pasangkan nama bangun yang sesuai dengan gambar yang diberikan.

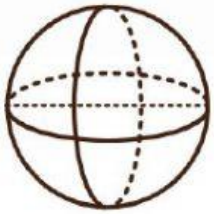

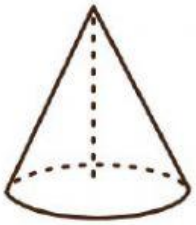

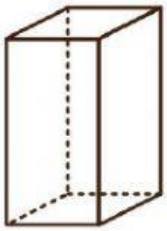

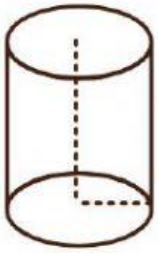

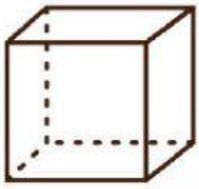

- Kerucut
- Bola
- Kubus
- Balok
- Tabung

LIVEWORKSHEETS

Bangun Ruangku

Lingkarilah pada nama yang tepat untuk gambar di samping.

Kubus Balok Tabung

Prisma Segitiga Kerucut



Kubus Balok Tabung

Prisma Segitiga Kerucut

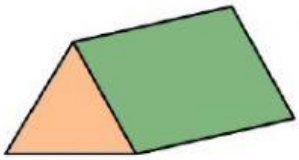

Kubus Balok Tabung

Prisma Segitiga Kerucut

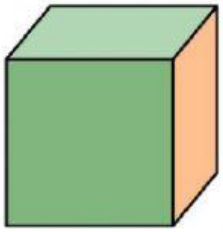

Kubus Balok Tabung

Prisma Segitiga Kerucut

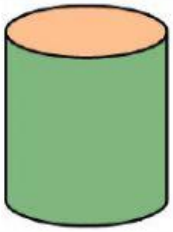

Kubus Balok Tabung

Prisma Segitiga Kerucut

LIVEWORKSHEETS

FINISH!

SEMANGAT TERUS YA BELAJARNYA!

LIVEWORKSHEETS