Beaconhouse School System

PECHS KG-I Campus

Name: _____ Class: _____ Date: _____

Instructions: Count and match the objects with the correct number name.

five



one



three



four

two

LIVEWORKSHEETS