Functii elementare. Reprezentari grafice

Asociază fiecărei reprezentări grafice de mai jos funcția corespunzătoare:

f(x) = x $\quad f(x)=x^2$ $\quad f(x)=x^3$ $\quad f(x)=\sqrt[n]{x}$, *n-par* $\quad f(x)=\sqrt[n]{x}$, *n-impar* $\quad f(x)=2^x$ $\quad f(x)=\left(\frac{1}{2}\right)^x$

$f(x)=\log_2 x$ $\quad f(x)=\log_{\frac{1}{2}} x$ $\quad f(x)=\sin x$ $\quad f(x)=\cos x$

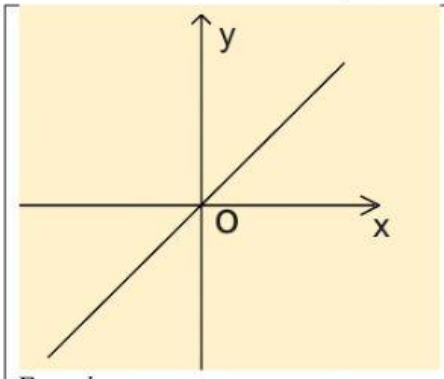

Funcția:

Legea funcției:

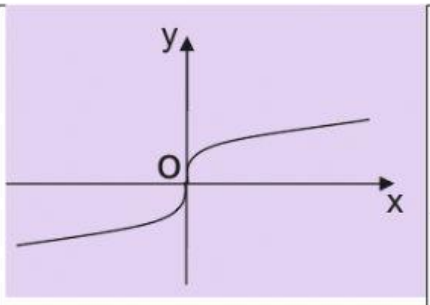

Funcția:

Legea funcției:

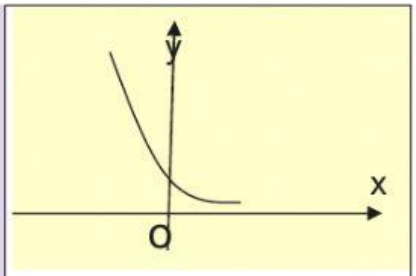

Funcția:

Legea funcției:

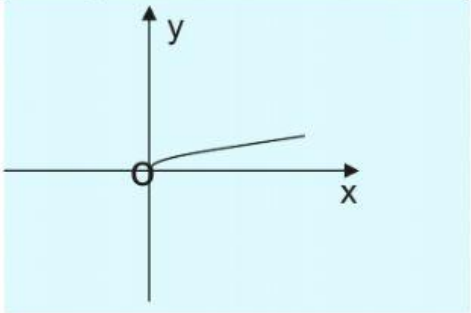

Funcția:

Legea funcției:

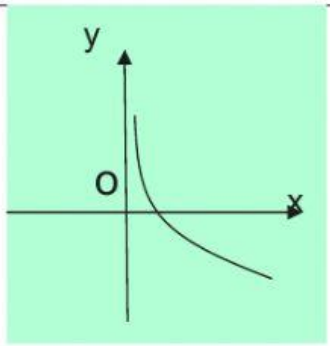

Funcția:

Legea funcției:

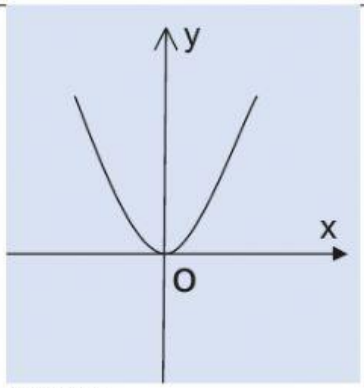

Funcția:

Legea funcției:

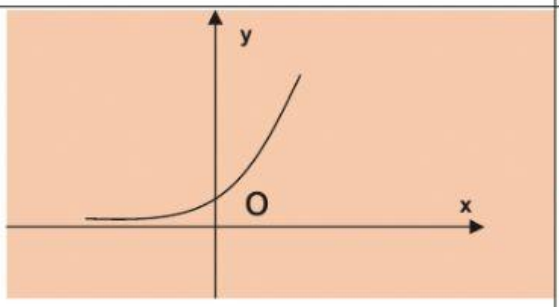

Funcția:

Legea funcției:

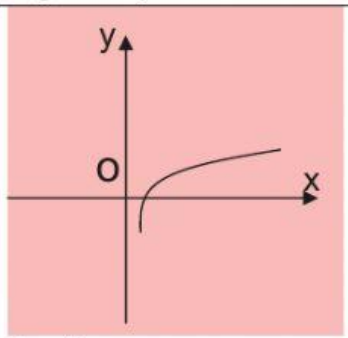

Funcția:

Legea funcției:

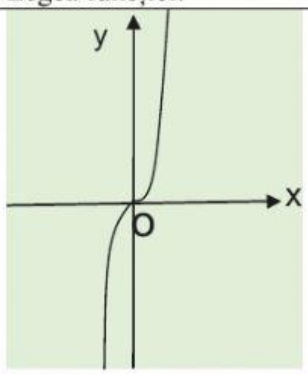

Funcția:

Legea funcției:

LIVEWORKSHEETS