Name: _____

Date_____

1. Write the following lenghts in feet

| | | | |
|---|---|---|---|
| **a.** 36 in. | _____ ft. | **b.** 24 in. | _____ ft. |
| **c.** 48 in. | _____ ft. | **d.** 72 in. | _____ ft. |
| **e.** 108 in. | _____ ft. | **f.** 12 in. | _____ ft. |

2. Find the perimeter of these shapes.

**a.**




P = _____

**b.**

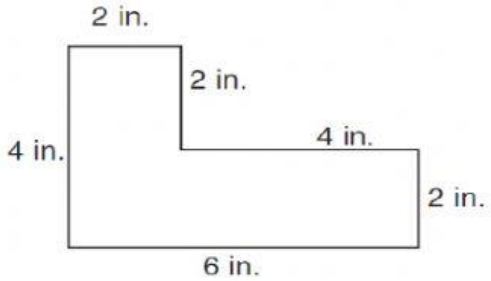


P = _____

**c.**




**d.**




Activar Windov

2. Change from feet to inches.

a. ½ ft. = _____in.

b. A Yard fabric cost $2. What is the cost of half a yard? _____

LIVEWORKSHEETS