L'ADDIZIONE…E LE SUE PROPRIETA'

LEGGI, COMPLETA CON I DATI E RISOLVI IN RIGA E IN COLONNA. POI RISPONDI

NELLA BOTTEGA DI LEO CI SONO 32 PENNELLI CON LA PUNTA SOTTILE E 27 PENNELLI CON LA PUNTA SPESSA.

QUANTI PENNELLI CI SONO IN TUTTO NELLA BOTTEGA DI LEO?

DATI

…… ➡ ……..

…… ➡ ……..

OPERAZIONI IN COLONNA

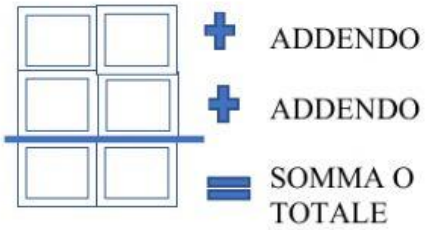

OPERAZIONI IN RIGA

…… = ……..

RISPOSTA

……

APPLICA LA PROPRIETA' COMMUTATIVA E COMPLETA

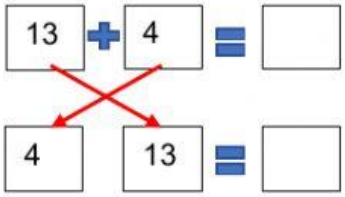

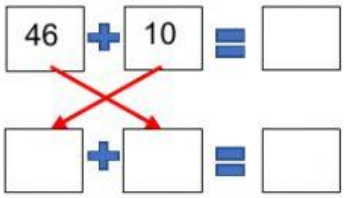

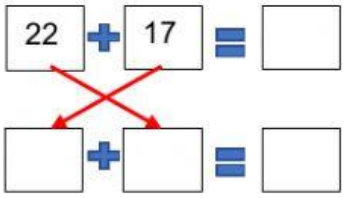

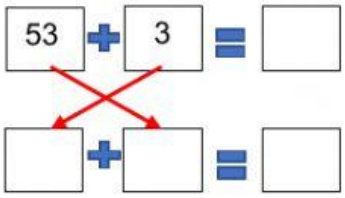

LA PROPRIETA' ASSOCIATIVA

APPLICA LA PROPRIETA' ASSOCIATIVA E COMPLETA COME NELL'ESEMPIO

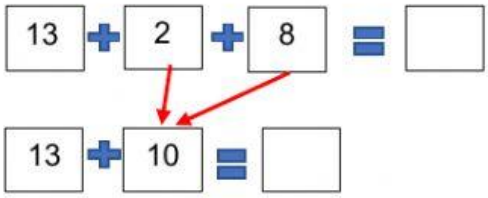

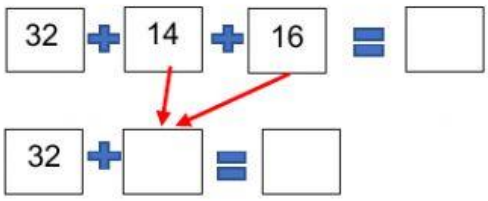

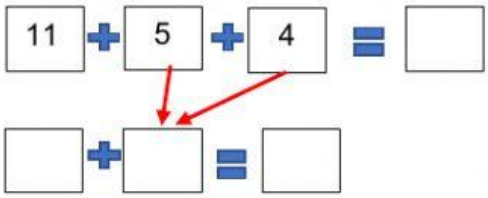

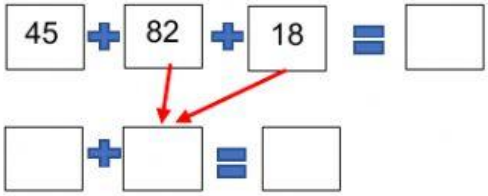

SEGNA QUALE PROPRIETA' DELL'ADDIZIONE E' STATA APPLICATA

	PROPRIETA' COMMUTATIVA	PROPRIETA' ASSOCIATIVA
228 + 406 = 406 + 228 = 634		
315 + 35 + 39 = 350 + 39 = 389		