Angles in shapes

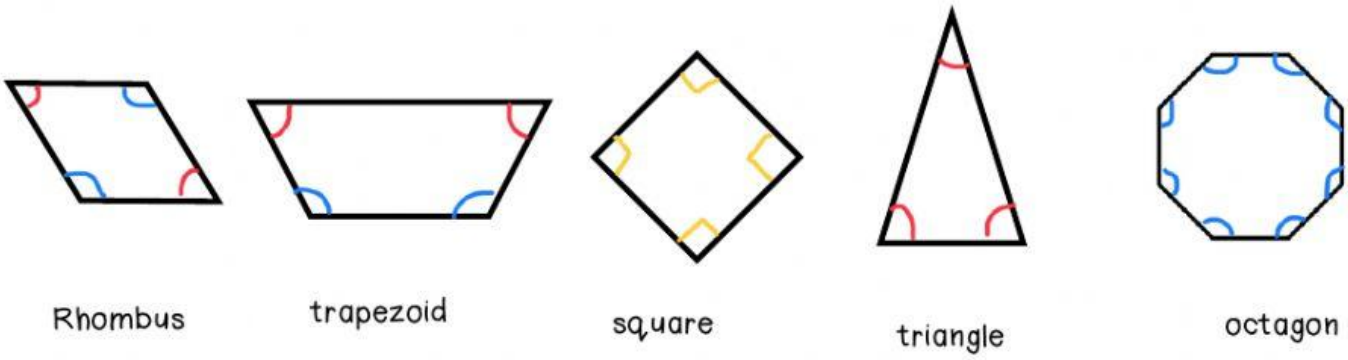

Which shape am I describing?

1) I have 2 acute angles and 2 obtuse angles.

2) I have got 3 acute angles.

3) I have got no acute angles.

4) I have got 8 obtuse angles.

5) I have got no right angles.

6) I have got 4 right angles.

Name the marked angle:

7. 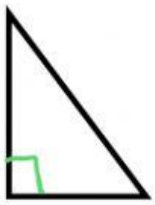

8. 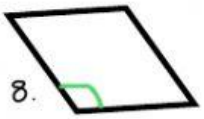

9.

10