Unit 2 Week 2 – Math Assessment

Name: _____ Score: _____ / 50

Look at each number line. Write the multiplication fact. (9 points)

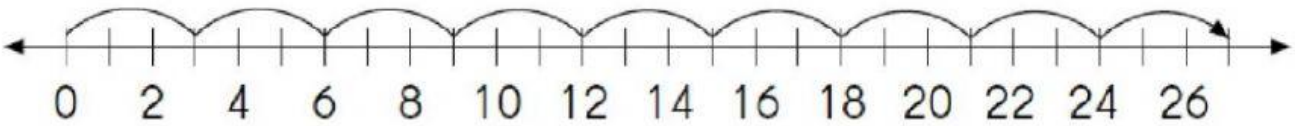

_____ × _____ = _____

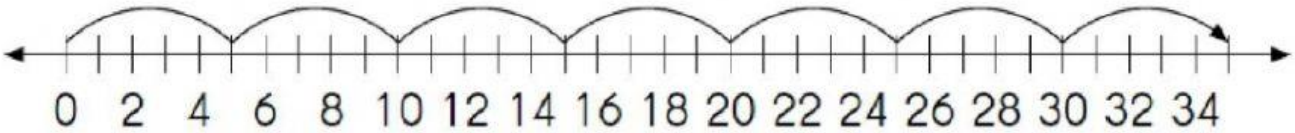

_____ × _____ = _____

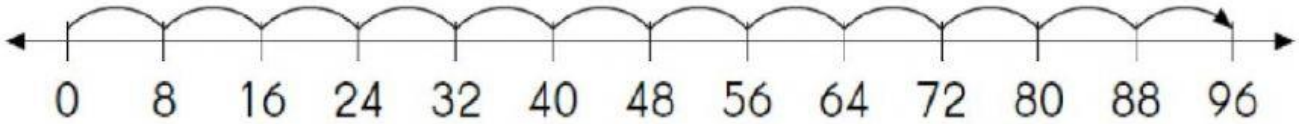

8 16 _____ _____ _____ 48

LIVEWORKSHEETS

Multiply. Use skip counting to help you. (8 points)

$8 \times 2 =$ _____	$7 \times$ _____ $= 56$
$5 \times 0 =$ _____	$8 \times$ _____ $= 72$
$7 \times 4 =$ _____	$9 \times$ _____ $= 54$
$6 \times 10 =$ _____	$6 \times$ _____ $= 42$

Circle to make equal groups.
Then fill in the missing numbers. (4 points)



$36 \div 4 =$ _____
Each group has

_____ diamonds.

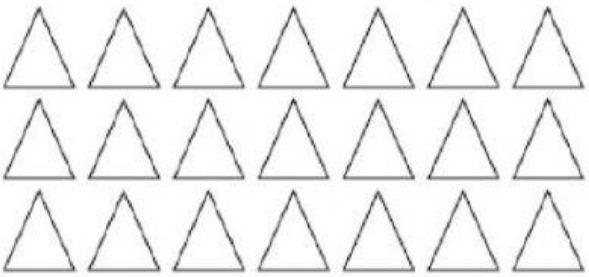

$21 \div 3 =$ _____
Each group has

_____ triangles.

LIVEWORKSHEETS

Fill in the missing numbers. (18 points)

4 × _____ = _____ × 4 = 20

_____ × 3 = 3 × _____ = 24

10 × _____ = _____ × 10 = 90

_____ × 5 = 5 × _____ = 45

9 × 6 = 6 × _____ = _____

10 × _____ = _____ × 10 = 60

_____ × 7 = 7 × _____ = 21

_____ × 7 = 7 × _____ = 0

40 = _____ × 8 = 8 × _____

LIVEWORKSHEETS

Fill in the missing numbers. (7 points)



×	1	3	5	9	8	7	4	6	1	0
8	8	24								

Solve. Show your work.

Siti has 9 dolls.
Each doll costs $6.
How much do the 9 dolls cost in all? (2 points)

Keenan spends $8 a day.
How much does he spend in a week? (2 points)

LIVEWORKSHEETS