Name:_____ Numeracy Grade 1syl

A. Match these



Fifth

11

fifteen

5th

second

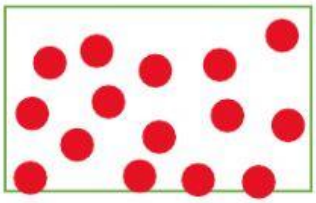

eleven

2nd

thirteen

B. Choose the correct answer

1. 8
   a. Eight b. eigth c. eighty

2. 12
   a. Twelve b. tweleve c. twenty

3. 7
   a. Sven b. seven c. sevn

LIVEWORKSHEETS

4. Which one is one more than 5



5. Which one is one less than 1

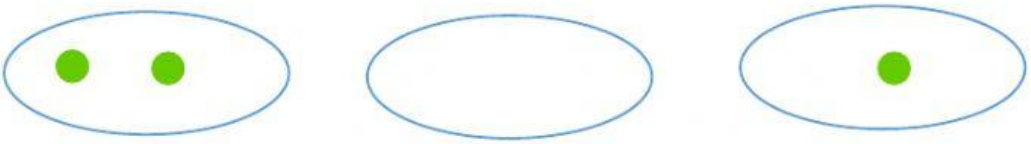

C. Write the correct answer

1. 1 less than 7 is ☐
2. 1 more than 9 is ☐
3. 2 more than 3 is ☐

D. Put the correct sign = , < or >

1.

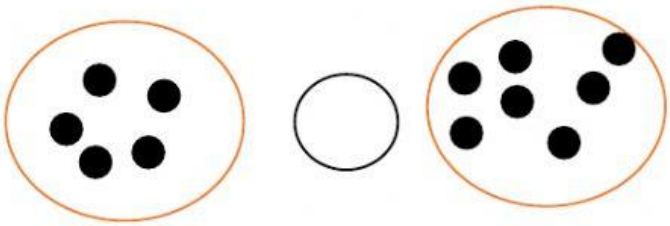

2.

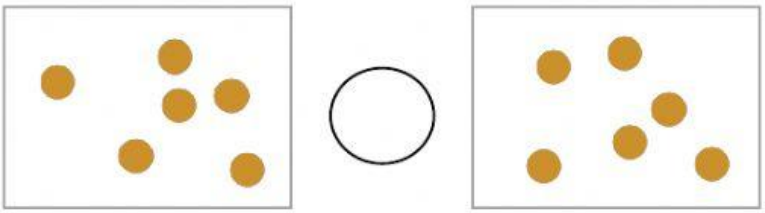

3.

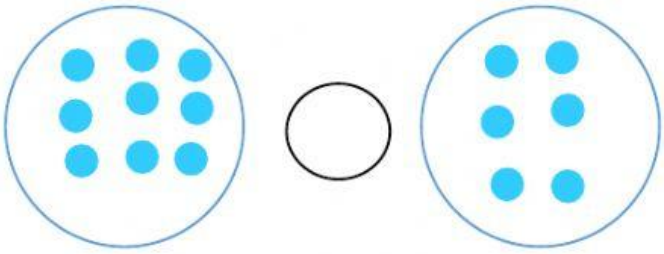

LIVEWORKSHEETS

E. Determine the position

2 nd yellow forth orange

a. Which colour boat finish 1st _____.

b. What position is the blue boat_____.

c. Which position is the boat after the orange boat_____.

d. What colour boat came third_____.

LIVEWORKSHEETS