Name: _____

Date: _____

Score: _____

TEAM PRACTICE #3

X-MULTIPLICATION-X

Example Find the M-NS:



Rows: _4__ NS:__4__ x __4__=_16__

Columns: _____

1) Find the M-NS:

Rows: _____ NS: _____ _____=_____

Columns: _____

2) Find the M-NS:

Rows: _____ NS: _____ _____=_____

Columns: _____

3) Find the M-NS:



Rows: _____ NS: _____ _____=_____

Columns: _____

4) Find the M-NS:

Rows: _____ NS: _____ _____=_____

Columns: _____

LIVEWORKSHEETS

5) Find the M-NS:

Rows: _____ NS: _____ _____=_____

Columns: _____

6) Find the M-NS:



Rows: _____ NS: _____ _____=_____

Columns: _____

7) Find the M-NS:

Rows: _____ NS: _____ _____=_____

Columns: _____

8) Find the M-NS:



Rows: _____ NS: _____ _____=_____

Columns: _____

9) Find the M-NS:

Rows: _____ NS: _____ _____=_____

Columns: _____

10) Find the M-NS:

Rows: _____ NS: _____ _____=_____

Columns: _____

11) Find the M-NS:

Rows: _____ NS: _____ _____=_____

Columns: _____

LIVEWORKSHEETS