Codeyoung

Concept_CW_G8_ An Introduction to Surface Area of Cylinders

Question 1: Work out the surface area of each of the following cylinders.
Give each answer to 2 decimal places.

(a)

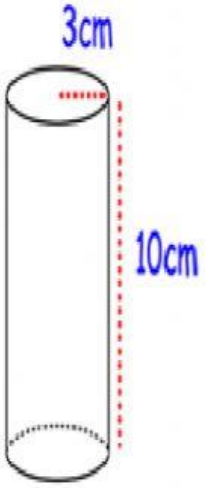

(b)

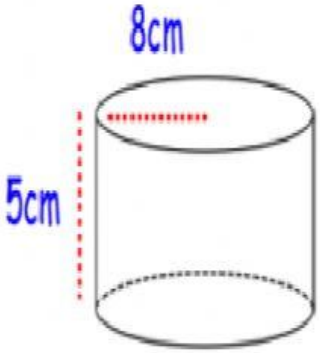

(c)

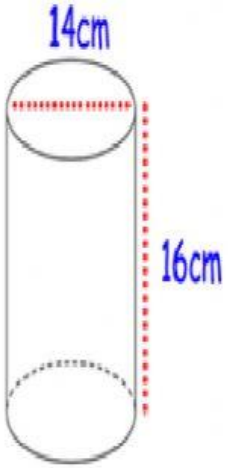

LIVEWORKSHEETS

Question Work out the height of each cylinder below

(a)

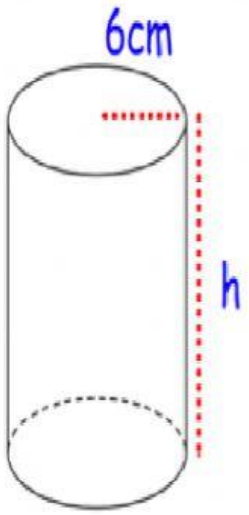

Surface area = 980.18cm^2

(b)

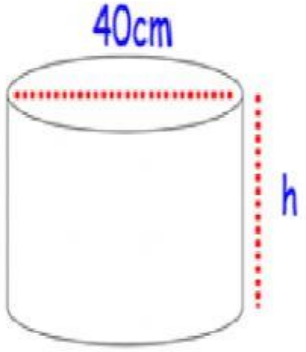

Surface area = 4715cm^2

(c)

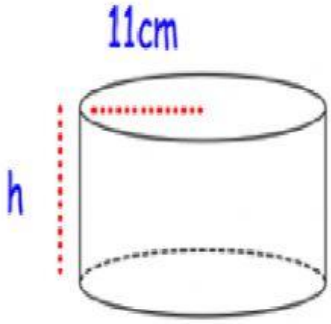

Surface area = 850cm^2

LIVEWORKSHEETS