POLIGONOAK ETA GORPUTZ GEOMETRIKOAK

Irakurri galderak eta aukeratu erantzun zuzena.
Kasu batzuetan erantzun egoki bat baino gehiago egon daitezke:

a. Zeinek EZ ditu marra zuzenik?



1. ☐ 2. ☐ 3. ☐ 4. ☐

b. Zein da pentagonoa?

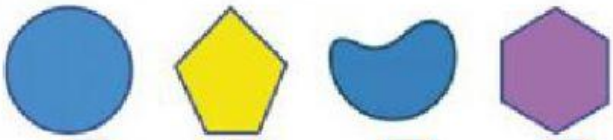

1. ☐ 2. ☐ 3. ☐ 4. ☐

c. Zein da poligonoa?

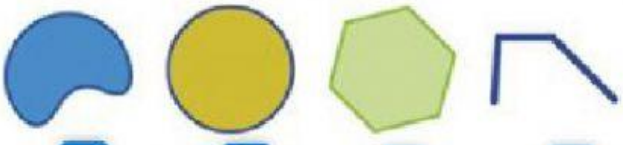

1. ☐ 2. ☐ 3. ☐ 4. ☐

d. Zein EZ da poligonoa?



1. ☐ 2. ☐ 3. ☐ 4. ☐

e. Zein dago marra zuzenez osatuta?

1. ☐ 2. ☐ 3. ☐ 4. ☐

f. Zeinek ez du marra zuzenik?

1. ☐ 2. ☐ 3. ☐ 4. ☐

a. Zein da hiru aldeko poligonoa?



1. ☐ 2. ☐ 3. ☐ 4. ☐

b. Zein da prisma?

1. ☐ 2. ☐ 3. ☐ 4. ☐

c. Zein da piramidea?

1. ☐ 2. ☐ 3. ☐ 4. ☐

d. Zein da esfera?

1. ☐ 2. ☐ 3. ☐ 4. ☐

e. Zein da zilindroa?



1. ☐ 2. ☐ 3. ☐ 4. ☐

f. Zein da konoa?



1. ☐ 2. ☐ 3. ☐ 4. ☐

a. Zeinek EZ du oinarri planorik?

1. ☐ 2. ☐ 3. ☐ 4. ☐

b. Zein da zilindroa?



1. ☐ 2. ☐ 3. ☐ 4. ☐

c. Zein da esfera?

1. ☐ 2. ☐ 3. ☐ 4. ☐

d. Zeinek EZ ditu gainazal kurbatuak?



1. ☐ 2. ☐ 3. ☐ 4. ☐

e. Zeinek ditu erpinak?

1. ☐ 2. ☐ 3. ☐ 4. ☐

f. Zein da prisma?

1. ☐ 2. ☐ 3. ☐ 4. ☐

a. Zeinek ditu bi oinarri plano?

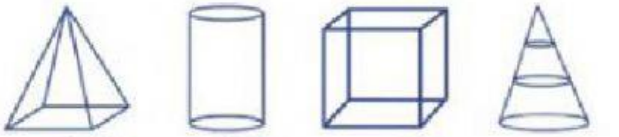

1. ☐ 2. ☐ 3. ☐ 4. ☐

b. Zein da prisma?

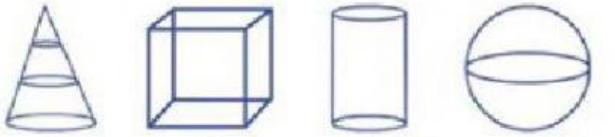

1. ☐ 2. ☐ 3. ☐ 4. ☐

c. Zein da piramidea?

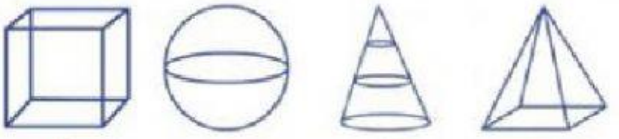

1. ☐ 2. ☐ 3. ☐ 4. ☐

d. Zein da esfera?

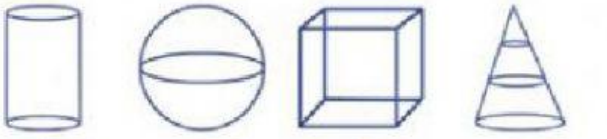

1. ☐ 2. ☐ 3. ☐ 4. ☐

e. Zein da esfera?

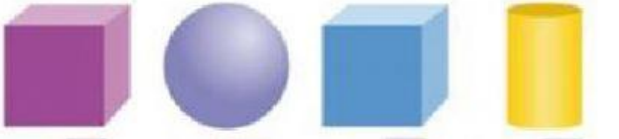

1. ☐ 2. ☐ 3. ☐ 4. ☐

f. Zein da konoa?

1. ☐ 2. ☐ 3. ☐ 4. ☐

a. Zein da konoa?

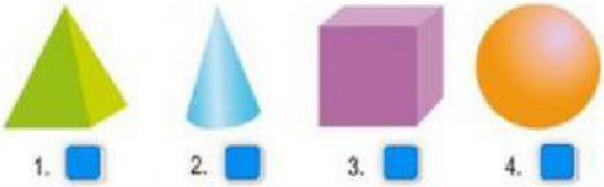

b. Zein da esfera?

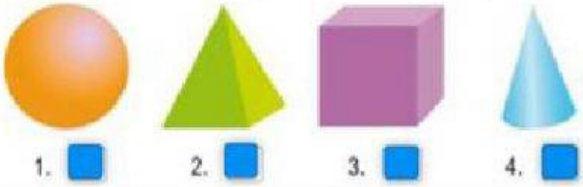

c. Zein da piramidea?

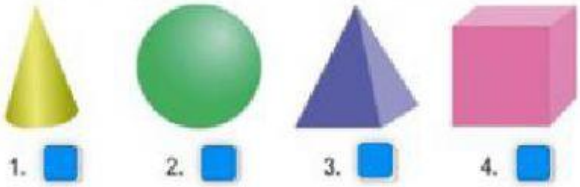

d. Zeinek EZ du gainazal planoa?

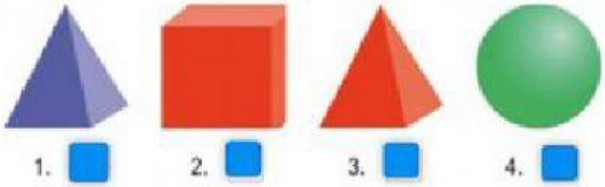

e. Zeinek ditu gainazak guztiak planoak?

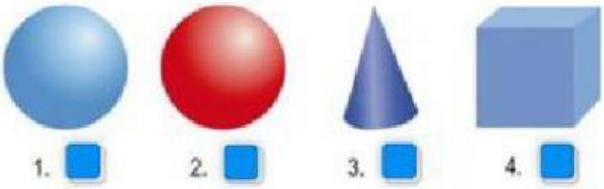

f. Zeinek du gainazak kurbatua?

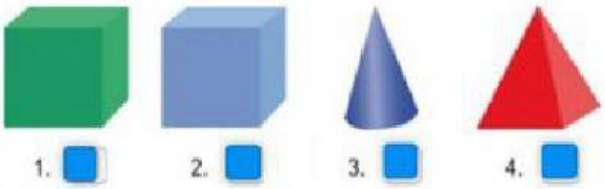

a. Zeinek EZ ditu gainazal planorik?

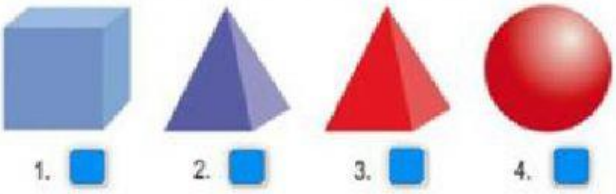

b. Zeinek EZ du gainazal kurbaturik?

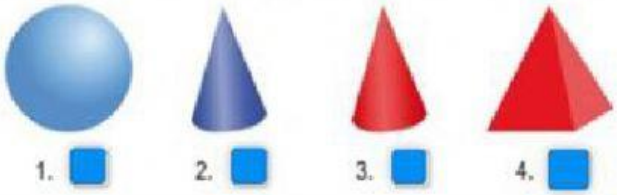

c. Zein EZ da prisma?

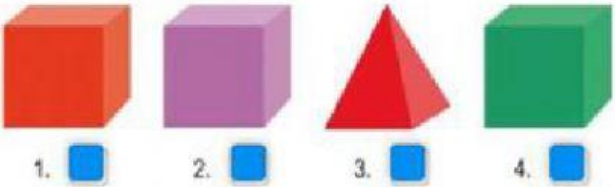

d. Zein EZ da piramidea?

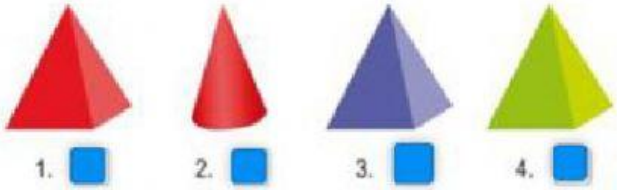

e. Zein EZ da konoa?

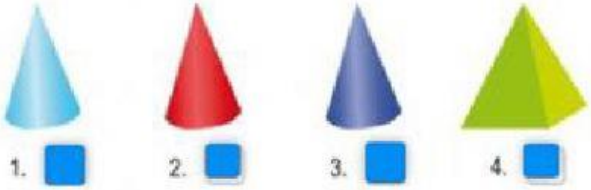
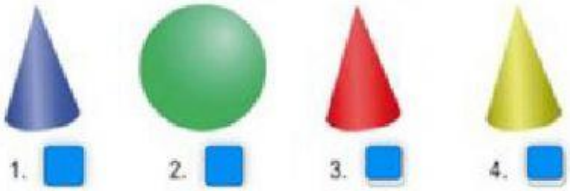
f. Zeinek EZ du gainazal planorik?