Geometría

1.- Completa esta tabla de polígonos regulares.

			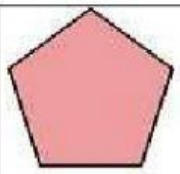	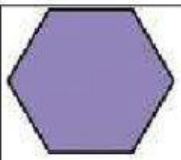
Nombre del polígono				
Número de lados				
Número de vértices				
Número de diagonales				

2.- Calcula el perímetro de los siguientes polígonos y traza sus diagonales.

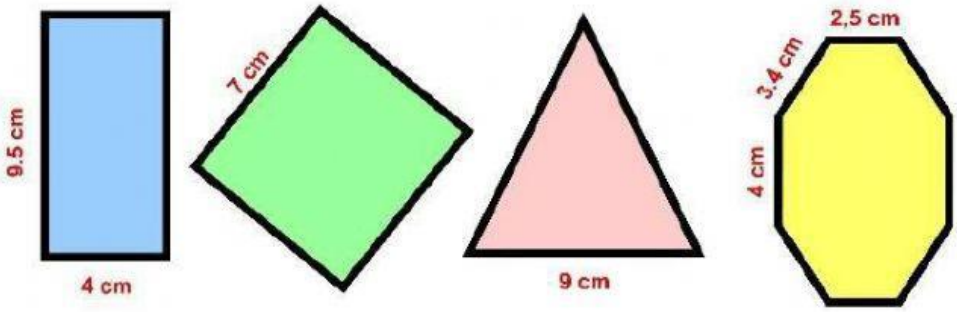

a) **b)** **c)** **d)**

P = **P =** **P =** **P =**

LIVEWORKSHEETS

3. Clasifica en agudos, obtusos y rectos los ángulos de esta figuras

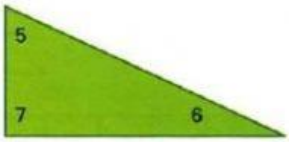

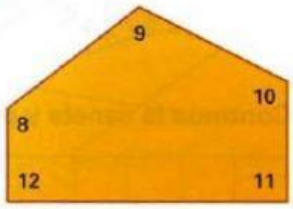

Ángulos rectos:	Ángulos agudos:	Ángulos obtusos:

4. Escribe junto a cada poliedro la letra que corresponde a su desarrollo plano

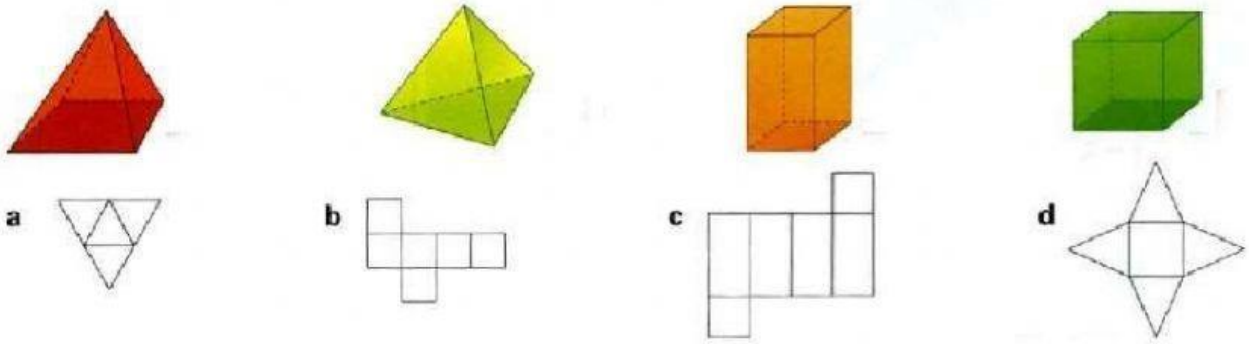

5. Calcula la superficie de los cuadrados y rectángulos siguientes

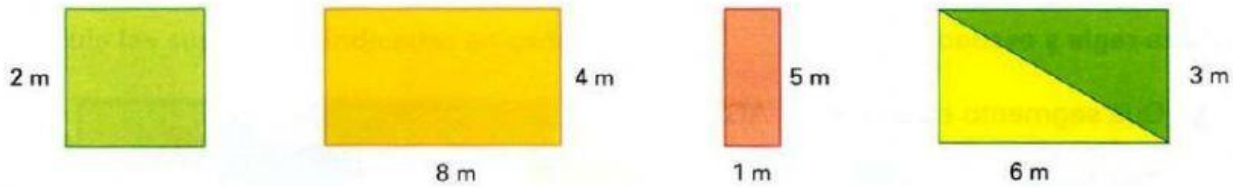

S = ... S = ... S= .....

En el último rectángulo:

¿Cuanto mide la superficie del triángulo verde? S = ...

LIVEWORKSHEETS