FRACCIONARIOS

¿Cuánto queso come el ratón?

Completa las siguientes operaciones de números fraccionarios.

1.- $\frac{3}{5}+\frac{2}{9}+\frac{1}{15}=$ ___ + ___ + ___ = ___

m.c.m(, ,)= x x =

2.- $\frac{3}{7}+\frac{5}{8}-\frac{1}{4}=$ ___ + ___ - ___ = ___

m.c.m(, ,)= x x x =

Arrastra el números fraccionarios correspondiente a la derecha de su representación gráfica.

3.-

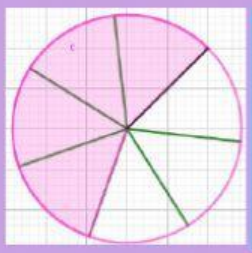

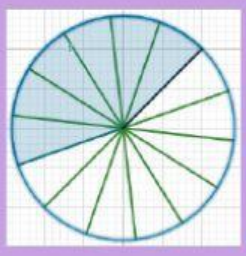



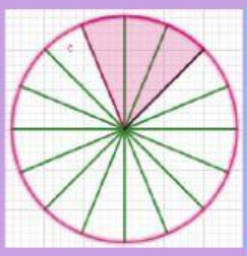

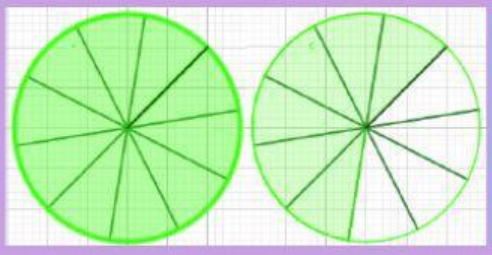

$\frac{1}{2}$ $1\frac{6}{10}$ $\frac{3}{16}$ $\frac{4}{7}$ $\frac{6}{14}$

Completa las fracciones equivalentes.

4.- $\frac{5}{7}=\frac{}{49}=\frac{40}{}=\frac{50}{}=\frac{}{14}=\frac{30}{}=\frac{}{63}$

LIVEWORKSHEETS