MATHS **BOXES AND SKETCHES** **GRADE 5**

NAME:

I. MARK THE TOP VIEW [T], SIDE VIEW [S] AND FRONT VIEW [F] OF THE FOLLWING FIGURES:









LIVEWORKSHEETS