Codeyoung

Application_Grade-3_Measurement

Consolidation of Unit Conversion and Comparison

Use your knowledge of the number system to read these scales which are going up ones, fives and tens.

1) How long is the line? ____ mm

2) How long is the line? ____ mm

3) How many ml? ___



4) How many ml? ___

5) How many ml? ___



6) How long is the line? ____ cm

7) How long is the line? ____ cm



8) How many g? ___

9) How many g? ___

10) How many g? ___

LIVEWORKSHEETS