Class-V, Mathematics

Can You See the Patterns?

Worksheet-2 (10)

1. What is the growth interval for the following sequences?(4x1=4)
   (a) 2, 4, 6, 8, 10, 12, 14, 16, 18, 20
   These numbers grow by …….

   (b) 45, 40, 35, 30, 25, 20, 15, 10, 5
   These numbers reduce by ……..

   (c) 5, 10, 15, 20, 25, 30, 35, 40, 45
   These numbers grow by …….

   (d) 27, 24, 21, 18, 15, 12, 9, 6, 3
   These numbers reduce by …….

2. Complete the following pattern by dragging the answer to the box:(6x1=6)

a)

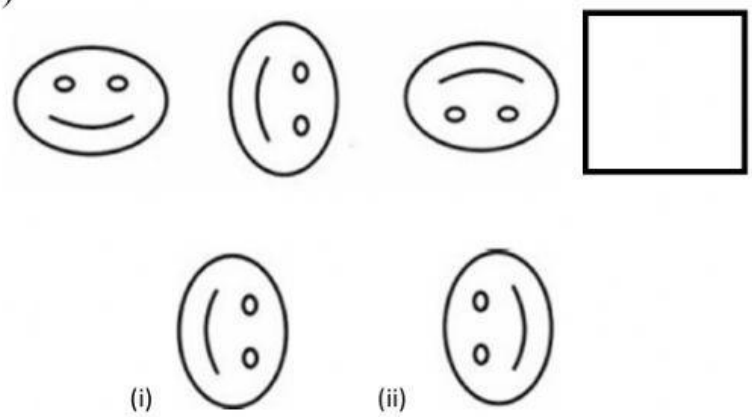

b)

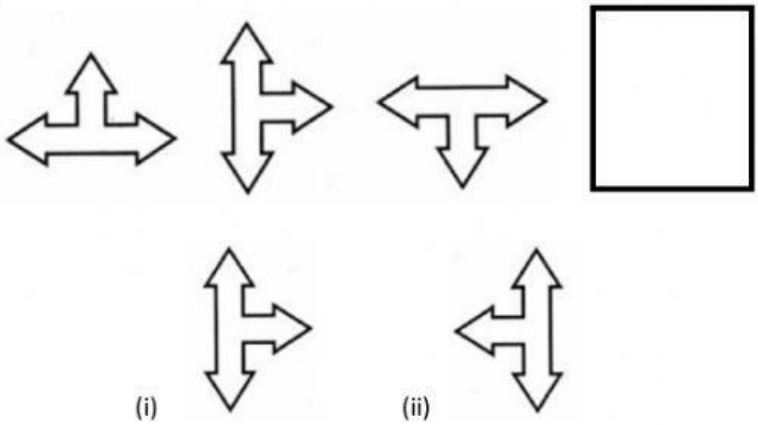

LIVEWORKSHEETS

c)

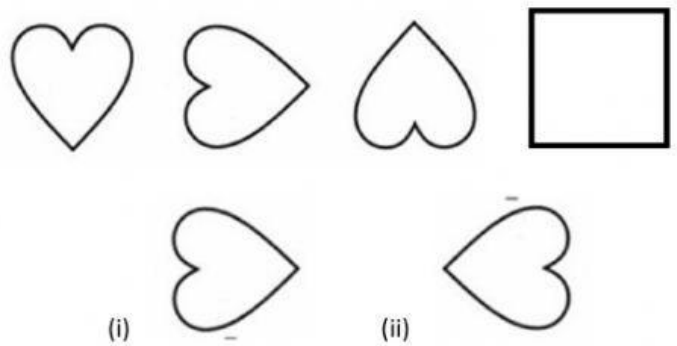

d)

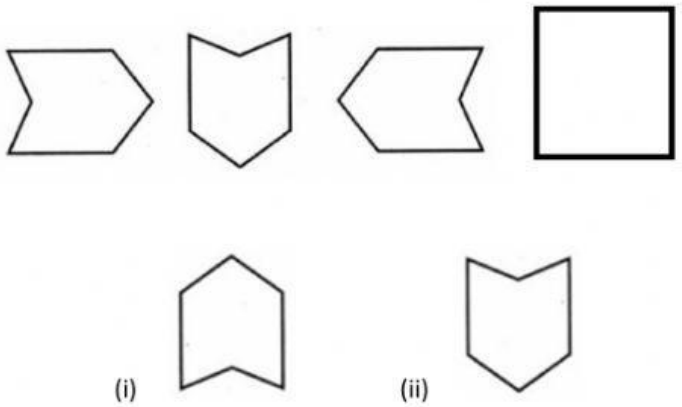

e)

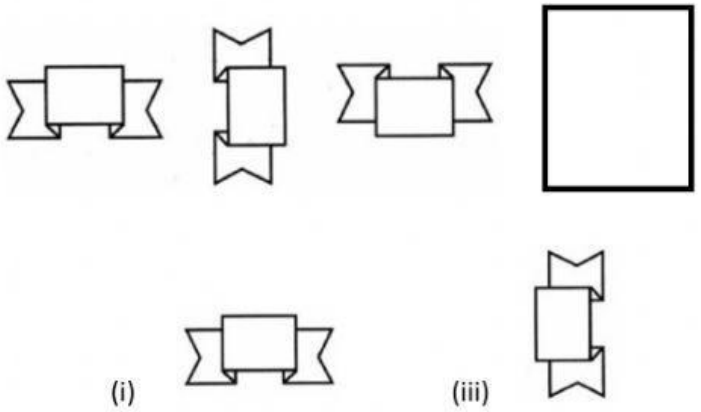

LIVEWORKSHEETS