1 Suma.



0 4 9 + 2 6 _____ ☐	0 4 4 + 3 7 _____ ☐	0 5 6 + 1 6 _____ ☐	0 2 8 + 5 8 _____ ☐

2 Calcula cuántos euros hay en cada caso.



☐



☐



☐



☐

3 Lee y resuelve.

Paola tenía 88 céntimos. Paga en la tienda de animales 55 céntimos. ¿Cuántos céntimos le quedan a Paola?

Tenía ☐ céntimos

Paga ☐ céntimos

Le quedan ☐ céntimos.