ICM INSAN CENDEKIA MADANI	Chapter 1 : Numbers to 100	Name :	
		Class :	
		Date :	
		Subject :	
		Teacher :	
☐ Pre-assessment ☐ Independent Practice	☐ Individual Guided Practice ✓ Formative Assessment	Marks 15	Grading

1. Let's count the following things!
   a. How many cookies are there? [2]

Answer :

   b. How many triangles are there?



Answer :

2. Find and Write the missing numbers! [3]

41	42		44	45		47		49	50
	52	53		55	56		58	59	

3. Write the following numbers in numerals! [3]
   a. Sixty-seven :_____
   b. Ninety-four : _____
   c. Forty-eight :_____

LIVEWORKSHEETS

4. Count on and count back [3]

a. Count on in twos starting from 70!



b. Count back in fives starting from 80!

c. Count on in tens starting from 94!

5. Show and tell numbers! [2]

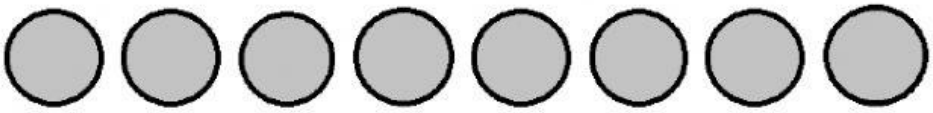

Based on the number of the circles above, color the circles below in one way with your pencil!

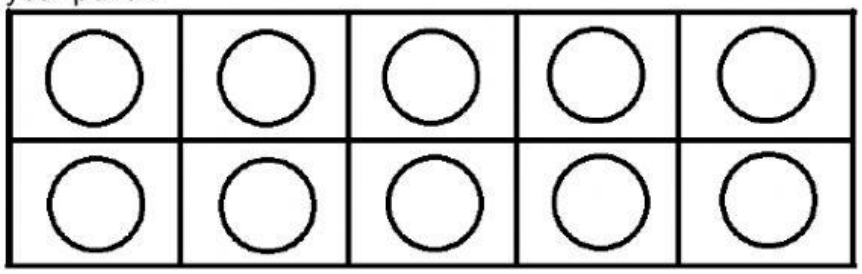

6. Look at the picture! By estimating, how many people are there! [2]

a. Estimate : _____

b. Actual : _____

LIVEWORKSHEETS