Use lattice multiplication method to find the product in each problem.

1) 45×68

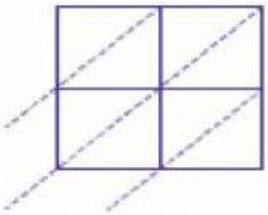

$45 \times 68 =$ _____

2) 18×72

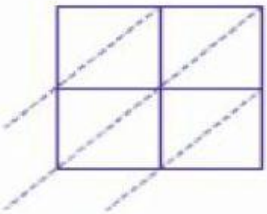

$18 \times 72 =$ _____

3) 36×24

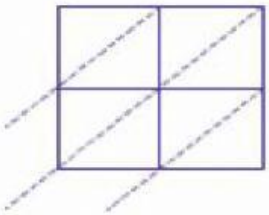

$36 \times 24 =$ _____

Use long method to answer the problems.

$$\begin{array}{r} 55 \\ \times\ 11 \\ \hline \end{array}$$

$$\begin{array}{r} 31 \\ \times\ 42 \\ \hline \end{array}$$

LIVEWORKSHEETS