Review 3

1. In each of the figures below, ABC is a straight line.
Find the unknown marked angles.

(a) Find ∠DBE.

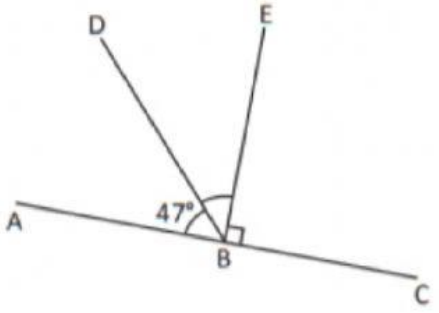

(b) $\angle p = \angle q = \angle r$. Find $\angle p$.

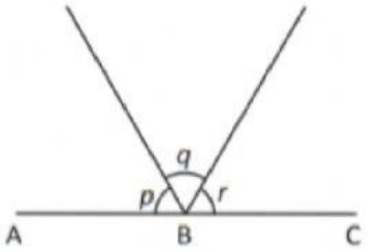

(c) Find $\angle x$.

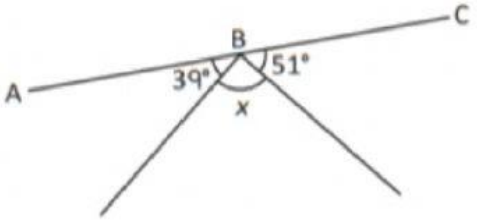

LIVEWORKSHEETS

2. Find the unknown marked angles.

(a) ABC is a straight line. Find ∠DBC and ∠EBF.

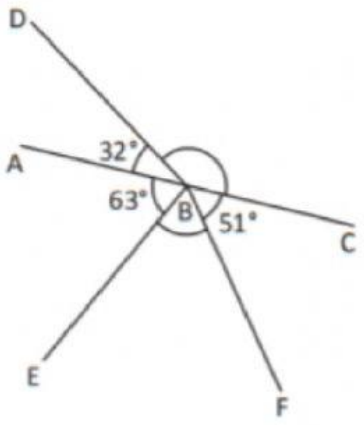

(b) XY is a straight line. Find ∠p and ∠q.

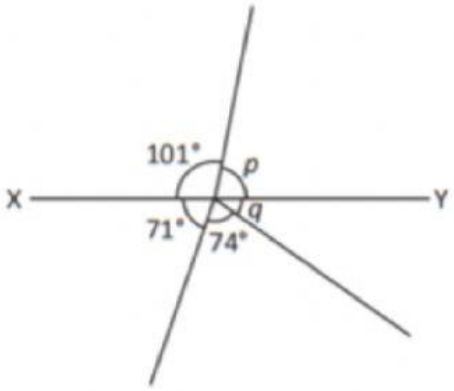

LIVEWORKSHEETS

3. Find the unknown marked angles.

(a) Find $\angle s$.

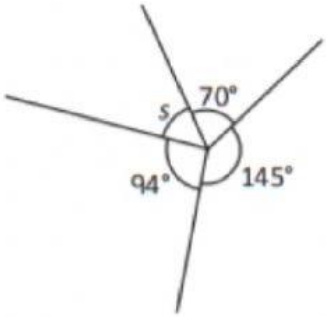

(b) Find $\angle q$.

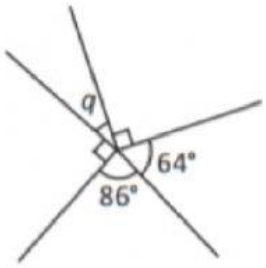

(c) Find $\angle x$.

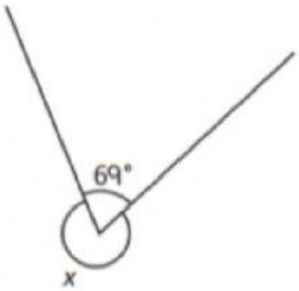

LIVEWORKSHEETS

4. AB and CD are straight lines. Find $\angle m$ and $\angle n$.

(a)

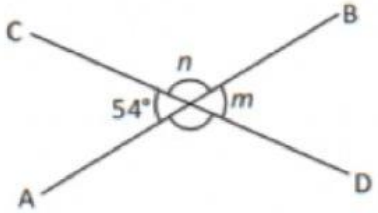

(b)

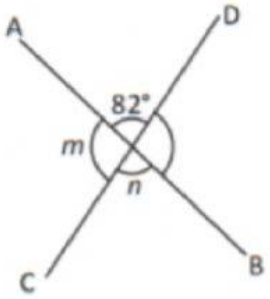

5. AOB and COD are straight lines. Find $\angle$COE, $\angle$COA and $\angle$BOD.

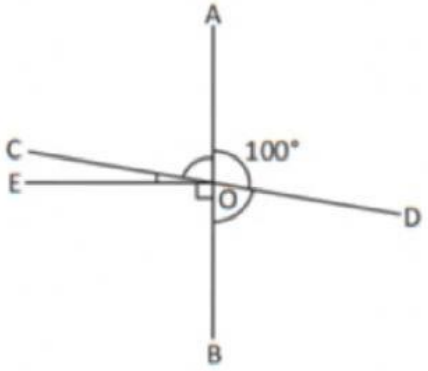

LIVEWORKSHEETS

6. Which of the following are equilateral triangles? Tick the correct boxes.

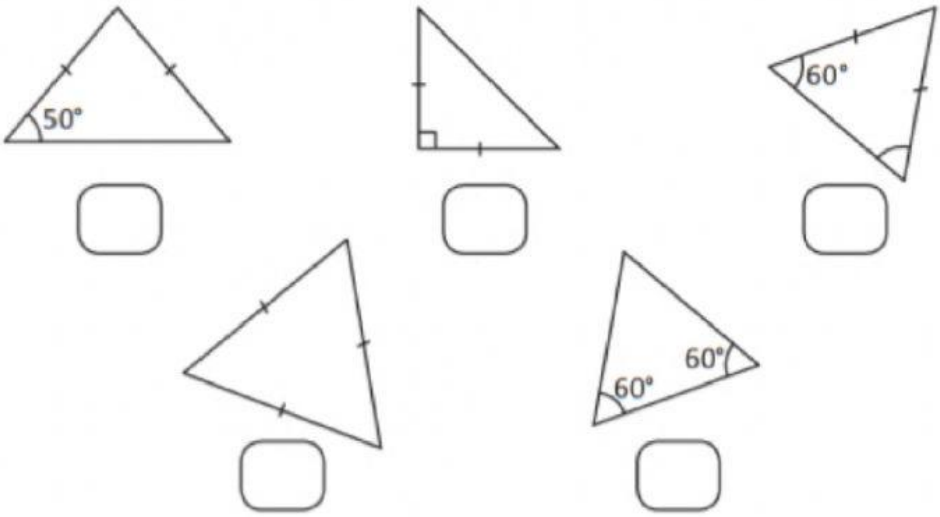

7. Find the unknown marked angles.

(a) Find $\angle a$.

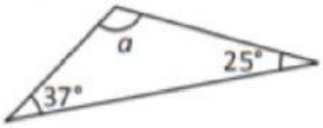

(b) Find $\angle b$.

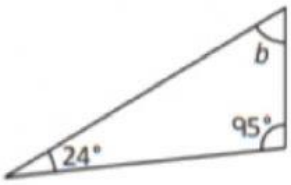

LIVEWORKSHEETS

(c) Find $\angle c$.

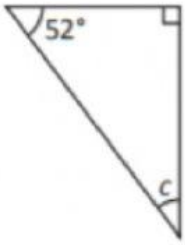

(d) Find $\angle d$.

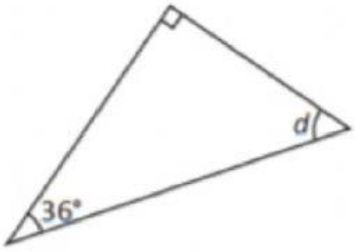

(e) Find $\angle e$.

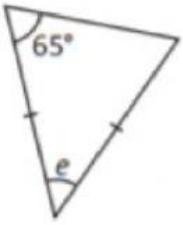

(f) Find $\angle f$.

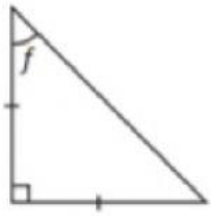

LIVEWORKSHEETS

(g) Find $\angle g$.

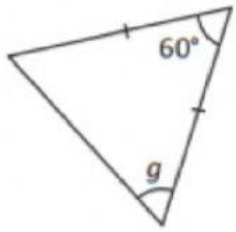

8. Find the unknown marked angles.

(a) Triangle BCD is an equilateral triangle. Find $\angle$ABD.

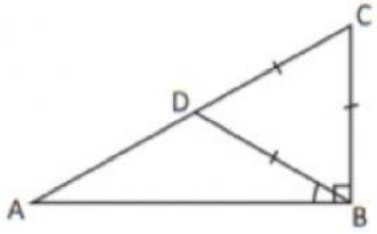

(b) Find $\angle$HFG.

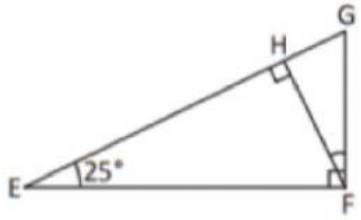

LIVEWORKSHEETS

(c) PQ = QR = RP. Find ∠QPS.

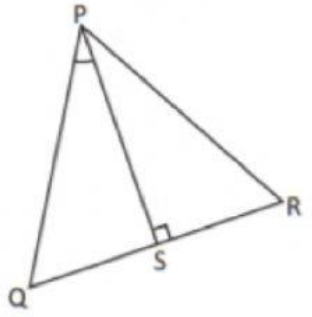

(d) Find ∠LON.

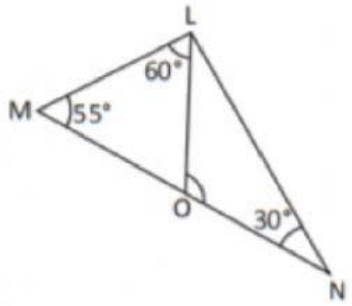

(e) PQ = PS and QT = TS. Find ∠PQT.

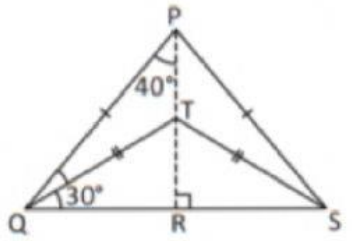

LIVEWORKSHEETS