Codeyoung

Application_Grade-7_Perimeter and Area

Area and Perimeter of Composite Shapes

Find the area of the shaded region in each figure. (use π = 3.14)

1)

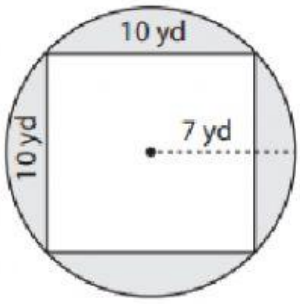

Area = _____

2)

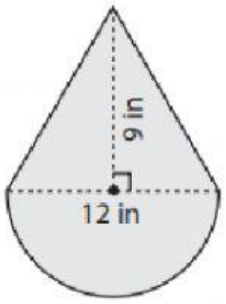

Area = _____

3)

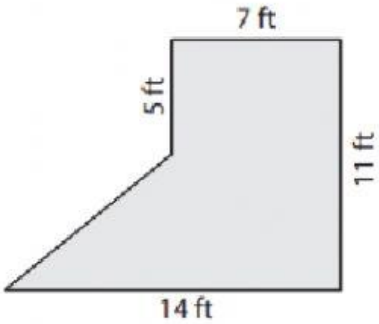

Area = _____

4)

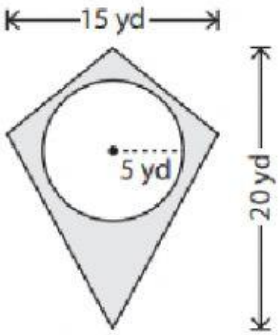

Area = _____

5)

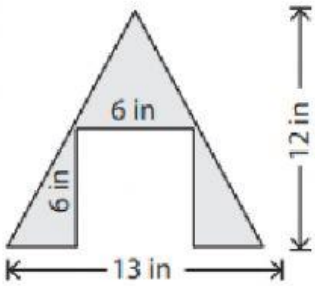

Area = _____

6)

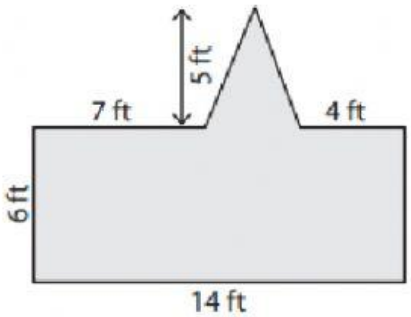

Area = _____

LIVEWORKSHEETS

Codeyoung

Find the perimeter of each shape.

1)

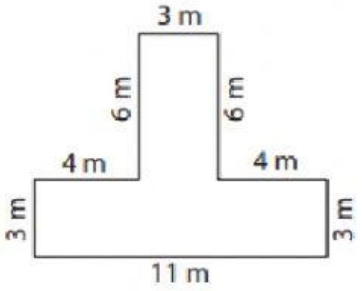

Perimeter = _____

2)

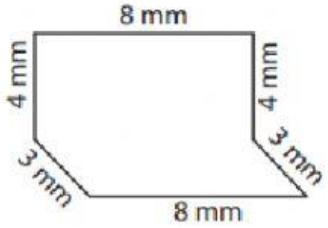

Perimeter = _____

3)

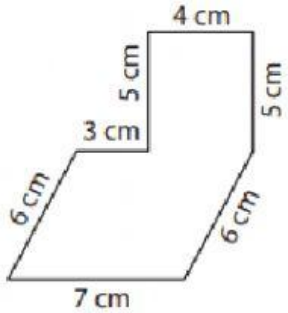

Perimeter = _____

4)

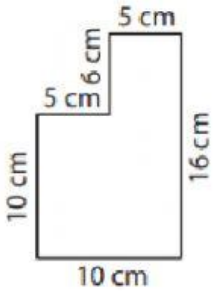

Perimeter = _____

5)

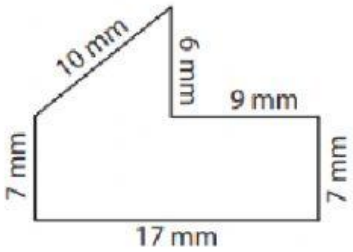

Perimeter = _____

6)

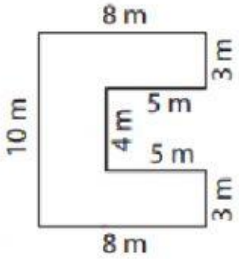

Perimeter = _____

7)

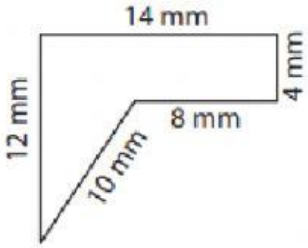

Perimeter = _____

8)

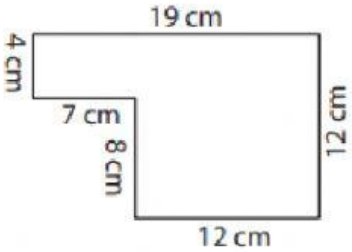

Perimeter = _____

9)

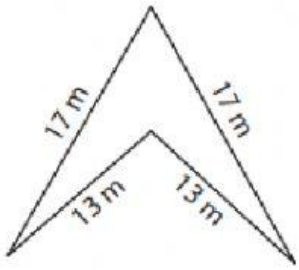

Perimeter = _____

LIVEWORKSHEETS