Codeyoung

Content HW_Grade-5_Geometry

Lines & Vertically Opposite Angles

1. 1) Which of the following is the vertically opposite angle of ∠AOE?

   i) ∠AOB ii) ∠DOE iii) ∠BOD iv) ∠COB

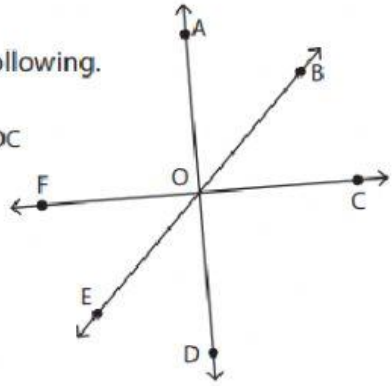

   2) Identify the vertically opposite angle of ∠EOF from the following.

   i) ∠BOC ii) ∠AOF iii) ∠COD iv) ∠EOC

   3) Write the the vertically opposite angle of ∠COD.

   4) Write the the vertically opposite angle of ∠FOB.

2. Tick the pairs of angles that are vertically opposite.



☐

☐

☐

☐

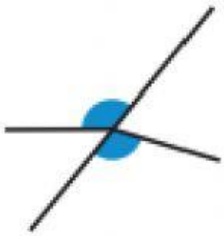

☐

LIVEWORKSHEETS