Pitagorasz tétele

1. Lehetnek-e a következő számok egy derékszögű háromszög oldalai?

7, 24, 25 IGEN/NEM

12, 16, 21 IGEN/NEM

4, 8, $\sqrt{80}$ IGEN/NEM

2. Hogy van helyesen a Pitagorasz tétel? Válaszd ki!

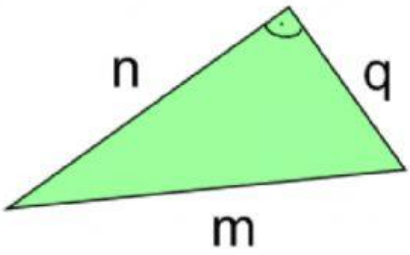

$$n^2 + m^2 = q^2$$
$$m^2 + q^2 = n^2$$
$$n^2 + q^2 = m^2$$

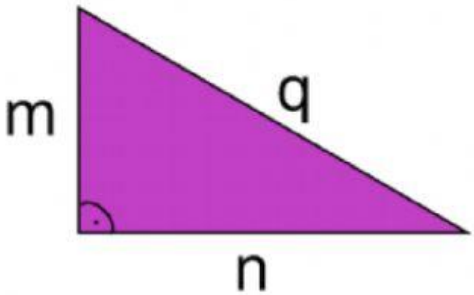

$$n^2 + m^2 = q^2$$
$$m^2 + q^2 = n^2$$
$$n^2 + q^2 = m^2$$

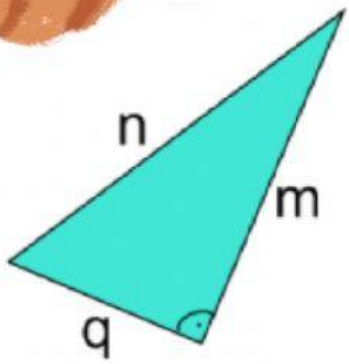

$$n^2 + m^2 = q^2$$
$$m^2 + q^2 = n^2$$
$$n^2 + q^2 = m^2$$

LIVEWORKSHEETS