EXCELSIOR INTERNATIONAL SCHOOL
SUMMATIVE TEST
SPELLING CLASS
LESSON: MODEL WITH ARRAYS

Name: _____ grade: 3° date:_____
score:___/15

I- Unlock the problem.Draw the array. 5pts

Sasha loves fruits. She plants 4 rows of grape plants with 5 plants in each row. How many grape plants are there?

II- Mental math

1) _____

2) _____

3) _____

4) _____

5) _____

LIVEWORKSHEETS

II- Check the models and answer…what multiplication sentence does this array show?

a. _____ x_____=_____



b. _____ x_____=_____



c. _____ x_____=_____

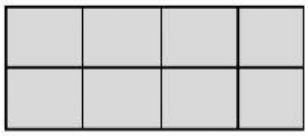

d. _____ x_____=_____

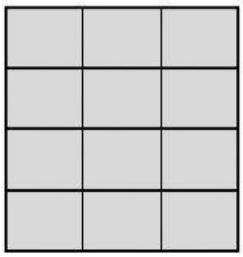

e. _____ x_____=_____



LIVEWORKSHEETS