Magister José Luis López López

INSTRUCCIONES: Calcule el área de las siguientes gráfica y escriba la respuesta correcta en el espacio en blanco; tomando en cuenta la variable x.



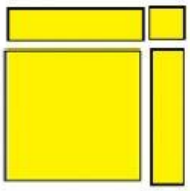





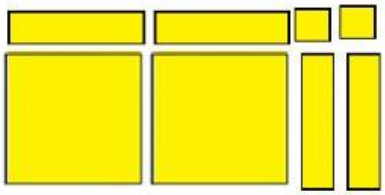

LIVEWORKSHEETS